Missing number & figure series : April 10

Special class

Ishwargiri Swamy • Apr 10, 2024

1) Add
2) Sub
3) Mul
4) Div
5) Sum
6) Custom

DR – CR - PC - 2020

Q. Find the missing number.

Q. ಕಾಣೆಯಾದ ಸಂಖ್ಯೆಯನ್ನು ಕಂಡುಹಿಡಿಯಿರಿ.

(a) 5 (b) 10

(c) 21 (d) 15

6 +	9 =	15
8 +	12 =	20
4 +	6 =	? 10

IGacademy Download App in PlayStore | SUBSCRIBE IshwarGiri ಪಾಠಶಾಲೆ | 8660070677

RRB JE - 2019

Q. Find the number to replace the question mark.

Q. ಪ್ರಶ್ನಾರ್ಥಕ ಚಿಹ್ನೆ ಇರುವಲ್ಲಿ ಬರಬೇಕಾದ ಸಂಖ್ಯೆ ಕಂಡುಹಿಡಿಯಿರಿ.

(a) 5 (b) 6

(c) 3 (d) 4

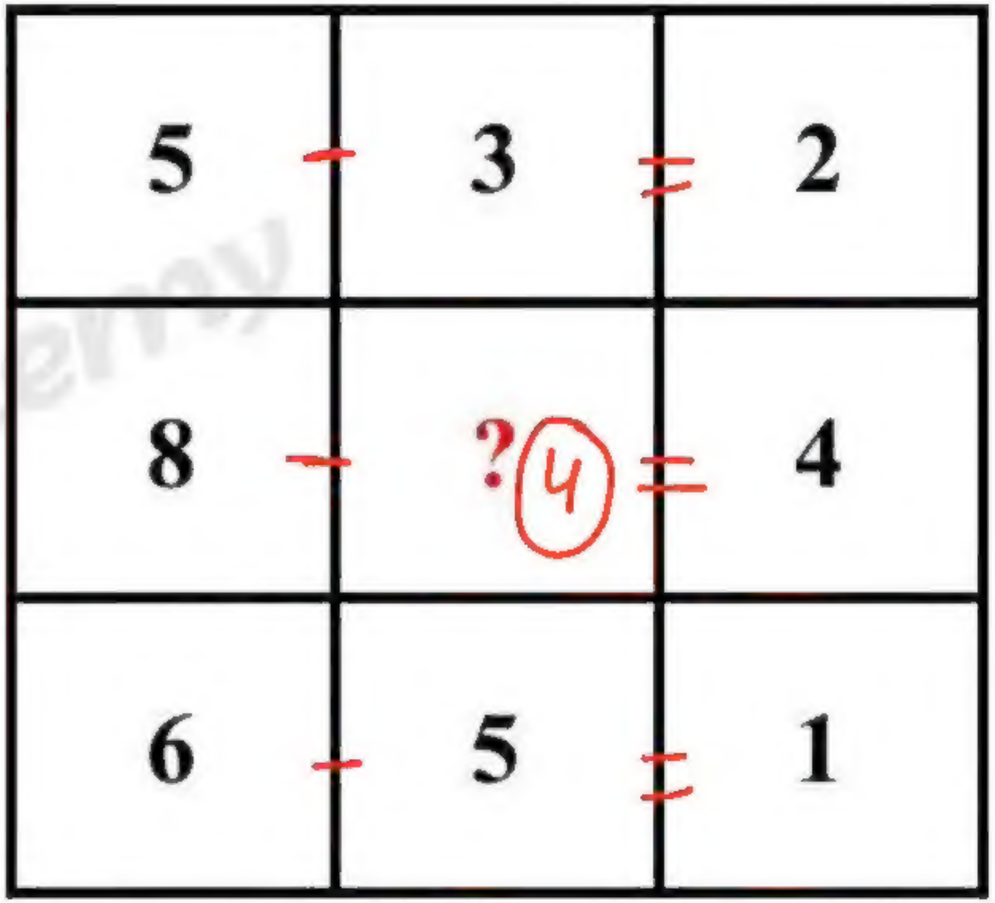

IGacademy
Download App in PlayStore
SUBSCRIBE
IshwarGiri ಪಾಠಶಾಲೆ
8660070677

SDA 2023

Q. In the following question which character will complete the given pattern, when placed at the sign of interrogation?

Q. ಈ ಕೆಳಗಿನ ಪ್ರಶ್ನೆಯಲ್ಲಿ ಯಾವ ಅಕ್ಷರವು ಪ್ರಶ್ನಾರ್ಥಕ ಚಿಹ್ನೆಯ ಸ್ಥಾನದಲ್ಲಿ ಬರುವ ಮೂಲಕ ನೀಡಿರುವ ವಿಧಾನವು (ಪ್ಯಾಟರ್ನ್) ಪರಿಪೂರ್ಣವಾಗುತ್ತದೆ?



(a) O
(b) K
(c) P
(d) N

IGacademy Download App in PlayStore | SUBSCRIBE IshwarGiri ಪಾಠಶಾಲೆ | 8660070677

SDA 2023



IGacademy Download App in PlayStore | SUBSCRIBE IshwarGiri ಪಾಠಶಾಲೆ | 8660070677

KAS - 2010

Q. The following four squares units is filled with the one appropriate rule. Fill the (?) marked box with correct option?

Q. ಈ ಕೆಳಗಿನ ನಾಲ್ಕು ಚೌಕಗಳ ಘಟಕಗಳಲ್ಲಿ ಒಂದು ನಿಯಮಾನುಸಾರವಾಗಿ ಅಂಕಿಗಳನ್ನು ತುಂಬಲಾಗಿದೆ. (?) ಚಿಹ್ನೆ ಇರುವಲ್ಲಿ ಯಾವ ಸಂಖ್ಯೆಯನ್ನು ತುಂಬಬೇಕು?

(a) 13 (b) 14 (c) 16 (d)17

1	6
4	5

4	8
6	7

7	11
8	10

10	15
10	?

IGacademy Download App in PlayStore | SUBSCRIBE IshwarGiri ಪಾಠಶಾಲೆ | 8660070677

KAS - 2010

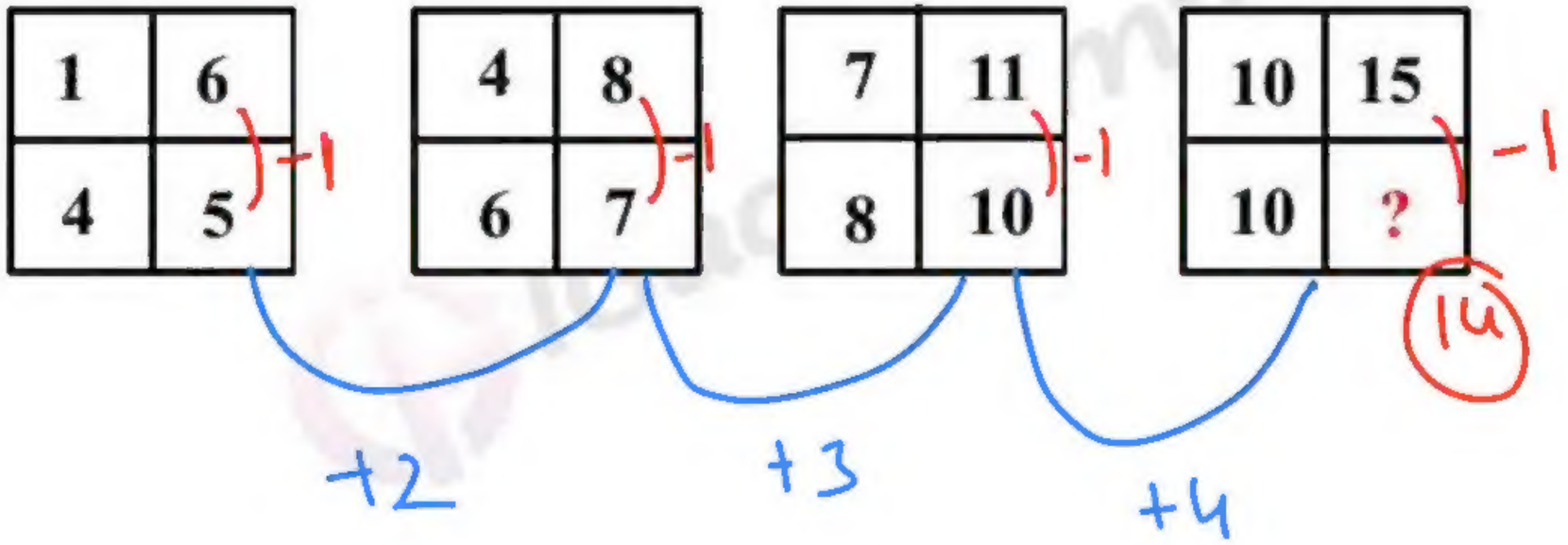

IGacademy Download App in PlayStore | SUBSCRIBE IshwarGiri ಪಾಠಶಾಲೆ | 8660070677

KSRP - SRPC - 2016

Q. Find the missing number .

Q. ಕಾಣೆಯಾದ ಸಂಖ್ಯೆಯನ್ನು ಗುರುತಿಸಿ .

(a) 72 **(b) 109** **(c) 119** **(d) 129**

$8 \times 9 = 72$

$16 \times 8 = 128$

$7 \times 17 = 119$

IGacademy Download App in PlayStore | SUBSCRIBE IshwarGiri ಪಾಠಶಾಲೆ | 8660070677

PSI – 2020

Q. Select the missing number.

Q. ಕಾಣೆಯಾದ ಸಂಖ್ಯೆಯನ್ನು ಆಯ್ಕೆ ಮಾಡಿ.

(a) 6 (b) 9

(c) 5 (d) 4

7	56	8
9	45	? (5)
11	99	9

7 X 8 = 56

11 X 9 = 99

9 X [5] = 45

IGacademy

Download App in PlayStore | SUBSCRIBE IshwarGiri ಪಾಠಶಾಲೆ | 8660070677

PSI – 2002

Q. Fill in the blank with the appropriate number.

Q. ಸರಿಯಾದ ಸಂಖ್ಯೆಯೊಂದಿಗೆ ಖಾಲಿ ಜಾಗವನ್ನು ತುಂಬಿರಿ.

(a)99 (b)117

(c)87 (d)57

13 X 9 = 117

IGacademy Download App in PlayStore | SUBSCRIBE IshwarGiri ಪಾಠಶಾಲೆ | 8660070677

SRPC (KSRP / IRB) - 2020

Q. Find the missing number in the diagram .

Q. ಈ ರೇಖಾಚಿತ್ರದಲ್ಲಿ ಸಂಖ್ಯೆಯನ್ನು ಕಂಡುಹಿಡಿಯಿರಿ.

(a) 11 **(b) 12**

(c) 22 ✓ **(d) 33**

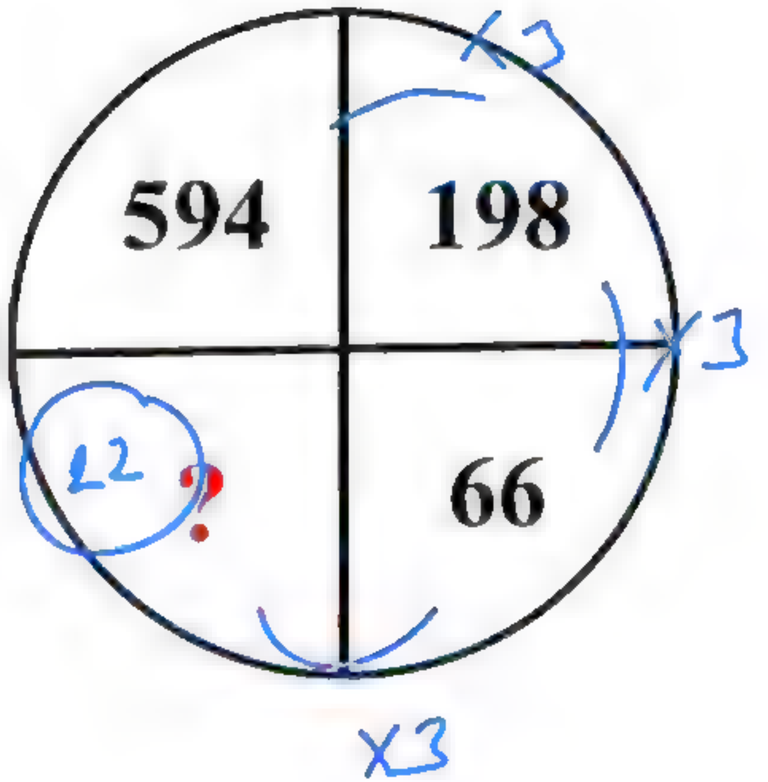

66 X 3 = 198

198 X 3 = 594

22 X 3 = 66

IGacademy Download App in PlayStore | SUBSCRIBE IshwarGiri ಪಾಠಶಾಲೆ | 8660070677

KPSC GROUP C - 2021

Q. Identify the missing number:

Q. ಕಾಣೆಯಾದ ಸಂಖ್ಯೆಯನ್ನು ಗುರುತಿಸಿರಿ :

(a) 56 **(b) 46** **(c) 43** **(d) 49** ✓

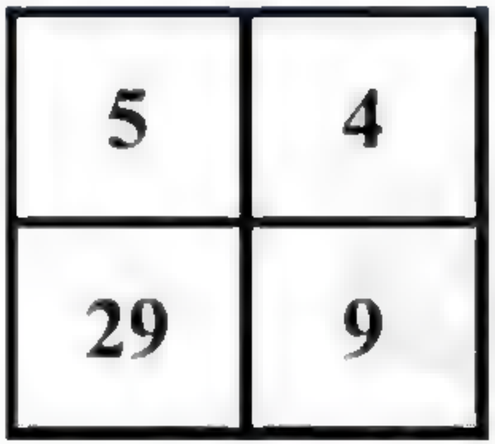

5	4
29	9

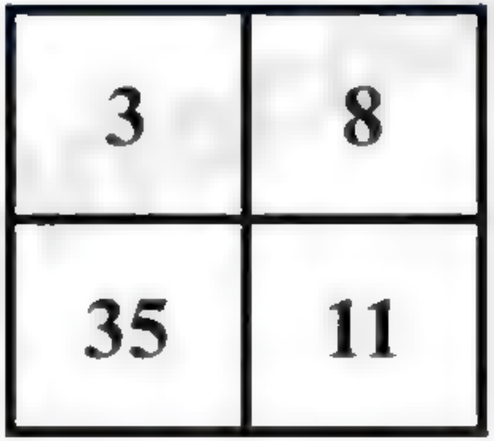

3	8
35	11



9	4
?	13

5 × 4 ⇒ 20 + 9 ⇒ 29 3 × 8 ⇒ 24 + 11 ⇒ 35 9 × 4 ⇒ 36 + 13 ⇒ 49

IGacademy Download App in PlayStore | SUBSCRIBE IshwarGiri ಪಾಠಶಾಲೆ | 8660070677

FDA 2023

Q. Find the missing number from the given alternatives.

Q. ಈ ಕೆಳಗೆ ನೀಡಲಾದ ಆಯ್ಕೆಗಳಿಂದ ಕಾಣೆಯಾಗಿರುವ ಸಂಖ್ಯೆಯನ್ನು ಗುರುತಿಸಿರಿ.

(a) 28 ✓ **(b) 16** **(c) 32** **(d) 8**

14+10=24

14	10
12	

24/2=12

10+42=52

10	42
26	

$\frac{52}{2}$ =26

42+14=56

42	14
?	

$\frac{56}{2}$ = 28

IGacademy Download App in PlayStore | SUBSCRIBE IshwarGiri ಪಾಠಶಾಲೆ | 8660070677

APC- 2017

Q. Find the missing number.

Q. ಕಾಣೆಯಾದ ಸಂಖ್ಯೆಯನ್ನು ಕಂಡುಹಿಡಿಯಿರಿ.

(a) 15 (b) 25 (c) 20 (d) 45

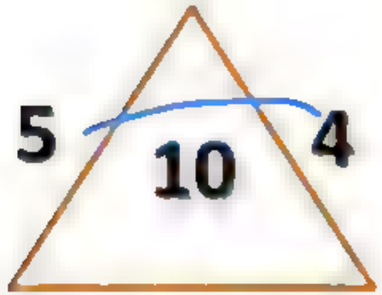

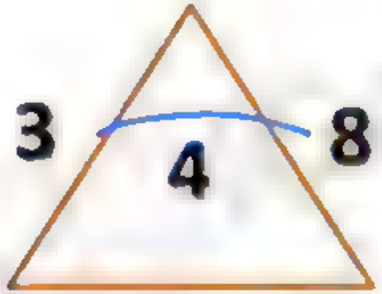

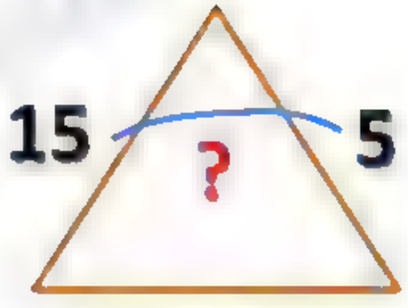

$5 \times 4 \Rightarrow \frac{20}{2} = 10$

$3 \times 8 \Rightarrow \frac{24}{6} = 4$

$15 \times 5 \Rightarrow \frac{75}{3} = 25$

IGacademy Download App in PlayStore | SUBSCRIBE IshwarGiri ಪಾಠಶಾಲೆ | 8660070677

PSI – 2017

Q. Find the missing character from among the given alternatives.

Q. ನೀಡಿದ ಪರ್ಯಾಯಗಳಲ್ಲಿ ಕಾಣೆಯಾದ ಸಂಖ್ಯೆಯನ್ನು ಗುರುತಿಸಿ.

(a) 22 **(b) 30** **(c) 32** **(d) 31**

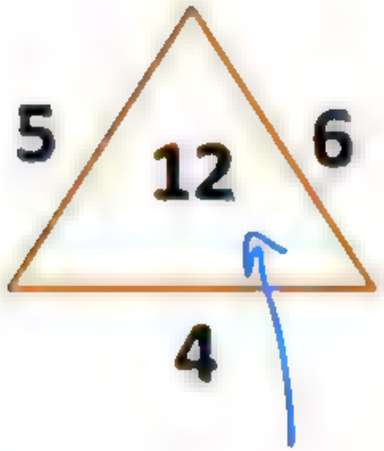

5X6X4 ⇒ 120

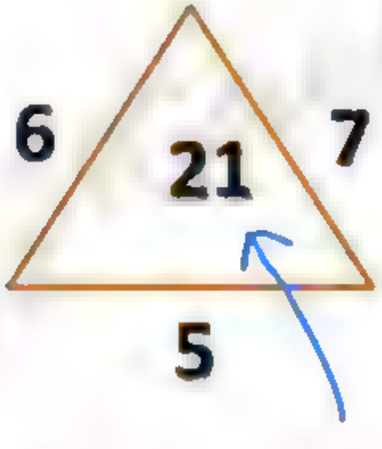

6X7X5 ⇒ 210



4X8X10 ⇒ 320

IGacademy Download App in PlayStore | SUBSCRIBE IshwarGiri ಪಾಠಶಾಲೆ | 8660070677

ESI – 2019

Q. Find the missing digit in this series.

Q. ಈ ಸರಣಿಯಲ್ಲಿ ತಪ್ಪಿ ಹೋಗಿರುವ ಅಂಕಿಯನ್ನು ಕಂಡು ಹಿಡಿಯಿರಿ.

(a) 122 (b) 124

(c)126 (d) 128

3	5	8	7
4	6	4	6
5	2	2	3
60-2	60-2	64-2	126-2
58	58	62	? 124

IGacademy Download App in PlayStore | SUBSCRIBE IshwarGiri ಪಾಠಶಾಲೆ | 8660070677

KPSC GROUP C - 2021

Q. Find the missing number :

Q. ಬಿಟ್ಟು ಹೋದ ಸಂಖ್ಯೆಯನ್ನು ಕಂಡುಹಿಡಿಯಿರಿ :

(a) 74 **(b) 63**

(c) 60 **(d) 65**

$3 \times 4 \times 5 \Rightarrow 60 + 12 \Rightarrow 72$

$2 \times 5 \times 6 \Rightarrow 60 + 13 \Rightarrow 73$

$5 \times 9 \times 1 \Rightarrow 45 + 15 \Rightarrow 60$

$(5 \times 9 \times 1) + (5 + 9 + 1) = 60$

3	2	5
4	5	9
5	6	1
72	73	?

(X) (+)

IGacademy Download App in PlayStore | SUBSCRIBE IshwarGiri ಪಾಠಶಾಲೆ | 8660070677

FDA - 2011

Q. Find out the number to replace the question mark.

Q. ಪ್ರಶ್ನಾರ್ಥಕ ಚಿಹ್ನೆ ಇರುವಲ್ಲಿ ಬರಬೇಕಾದ ಸಂಖ್ಯೆಯನ್ನು ಕಂಡುಹಿಡಿಯಿರಿ.

(a) 88 (b) 90 (c) 92 (d) 94

6	8	7	98

6 + 8 => 14

Y7

98

7	5	8	96

7 + 5 => 12

X8

96

8	7	6	? 90

8 + 7 => 15

X6

90

IGacademy Download App in PlayStore | SUBSCRIBE IshwarGiri ಪಾಠಶಾಲೆ | 8660070677

Civil & Intelligence PSI – 2018

Q. Which of the following is the missing number ?

Q. ಕೆಳಗಿನವುಗಳಲ್ಲಿ ಕಾಣೆಯಾಗಿರುವ ಸಂಖ್ಯೆ ಯಾವುದು ?

(a)14 (b)18 (c) 3 (d)1

7	21	8
17	? 14	5
12	1	23
36	36	36

IGacademy Download App in PlayStore | SUBSCRIBE IshwarGiri ಪಾಠಶಾಲೆ | 8660070677

1) Letter Series

2) Number Series

3) Figure Series

4
1
2

1

2

3

Figure Series

ಆಕೃತಿ ಸರಣಿ

Question Figures

Answer Figures

(a) (b) (c) (d)

Q. Select the figure from among the given options that can replace the question mark (?) in the following series.

Q. ಈ ಕೆಳಗಿನ ಸರಣಿಯಲ್ಲಿ ಪ್ರಶ್ನಾರ್ಥಕ ಚಿಹ್ನೆಯನ್ನು (?) ಬದಲಿಸಬಹುದಾದ ಆಯ್ಕೆಗಳ ಪೈಕಿ ಆಕೃತಿಯನ್ನು ಆಯ್ಕೆಮಾಡಿ.

Question Figures

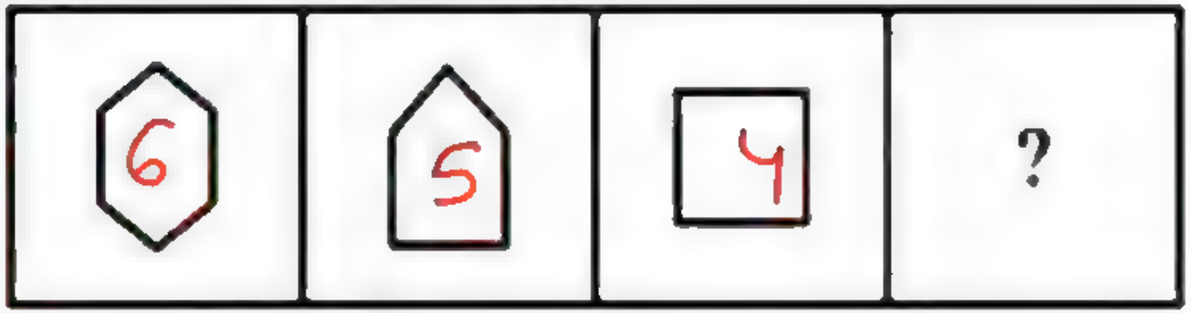

Answer Figures

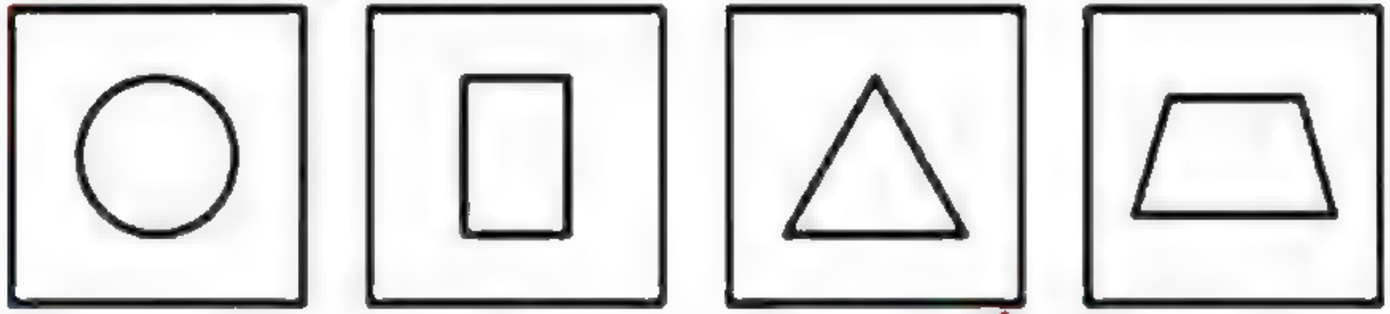

(a) (b) (c) (d)

IGacademy Download App in PlayStore | SUBSCRIBE IshwarGiri ಪಾಠಶಾಲೆ | 8660070677

Question Figures

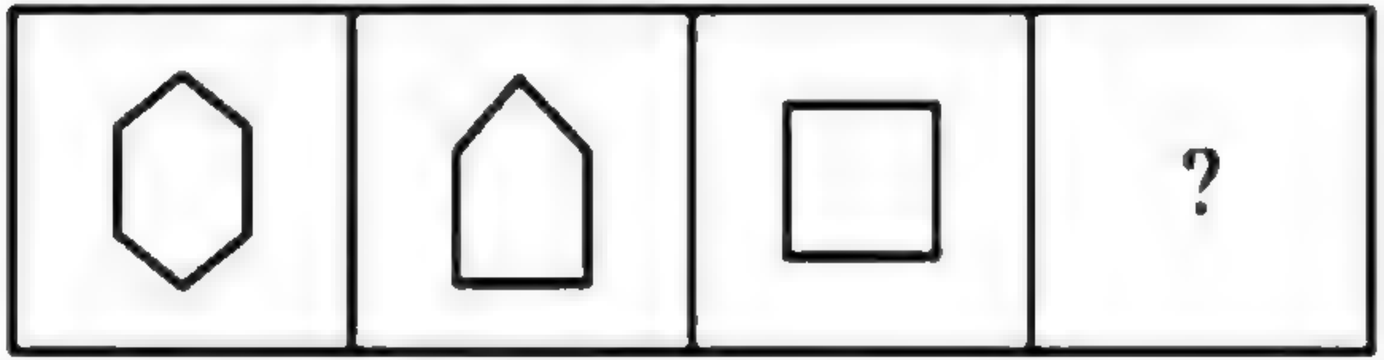

Answer Figures

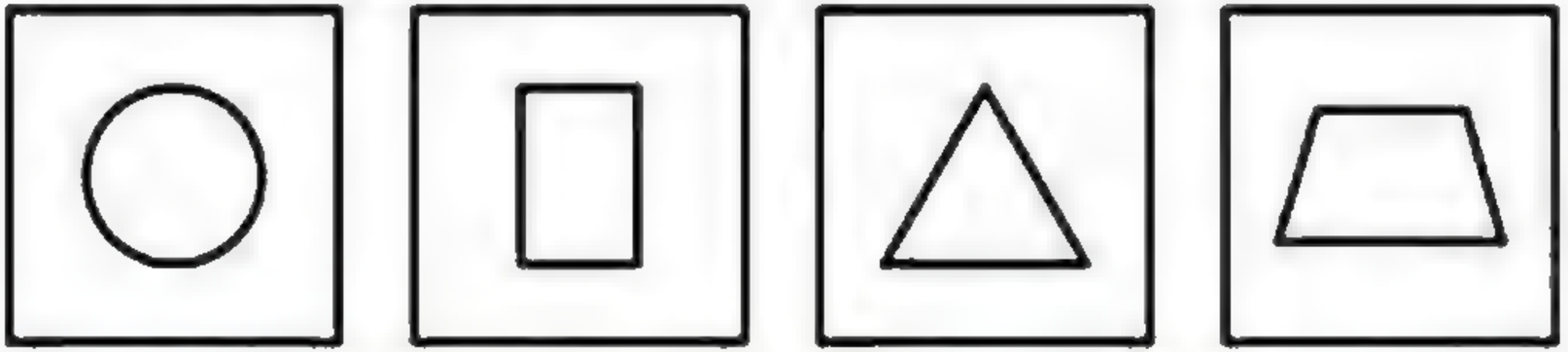

(a) (b) (c) (d)

IGacademy Download App in PlayStore | SUBSCRIBE IshwarGiri ಪಾಠಶಾಲೆ | 8660070677

Q. Select the figure from among the given options that can replace the question mark (?) in the following series.

Q. ಈ ಕೆಳಗಿನ ಸರಣಿಯಲ್ಲಿ ಪ್ರಶ್ನಾರ್ಥಕ ಚಿಹ್ನೆಯನ್ನು (?) ಬದಲಿಸಬಹುದಾದ ಆಯ್ಕೆಗಳ ಪೈಕಿ ಆಕೃತಿಯನ್ನು ಆಯ್ಕೆಮಾಡಿ.

Question Figures

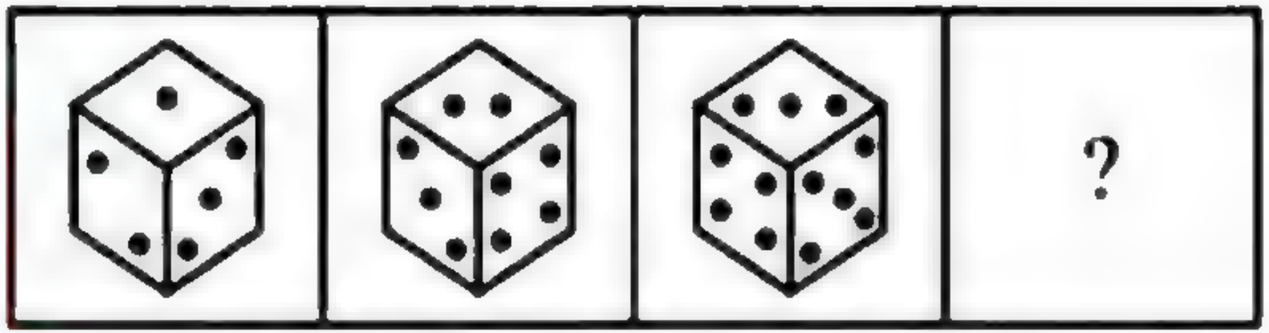

Answer Figures



(a) (b) (c) (d)

IGacademy Download App in PlayStore | SUBSCRIBE IshwarGiri ಪಾಠಶಾಲೆ | 8660070677

Question Figures



Answer Figures



(a) (b) (c) (d)

IGacademy Download App in PlayStore | SUBSCRIBE IshwarGiri ಪಾಠಶಾಲೆ | 8660070677

RSI 2023

Q. Complete the sequence.
ಕೊಟ್ಟಿರುವ ಅನುಕ್ರಮವನ್ನು
ಪೂರ್ಣಗೊಳಿಸಿ

(a) a (b) b
(c) c (d) d

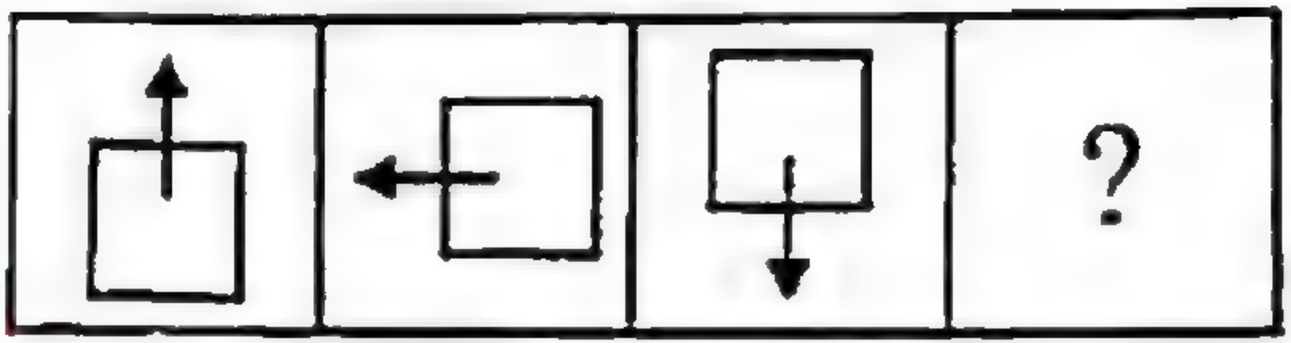

(a) 

(b) 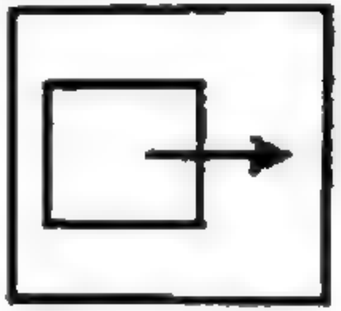

(c) 

(d) 

IGacademy Download App in PlayStore | SUBSCRIBE IshwarGiri ಪಾಠಶಾಲೆ | 8660070677

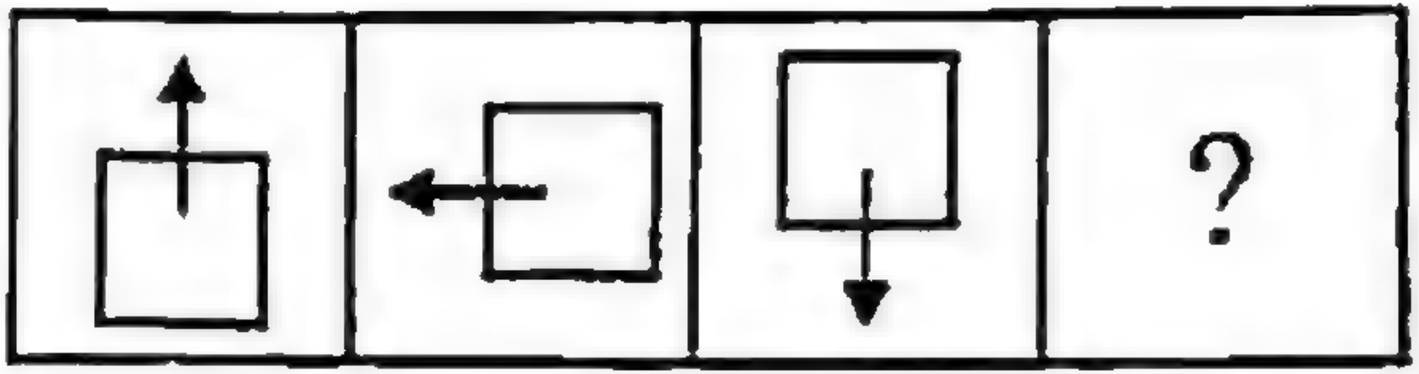

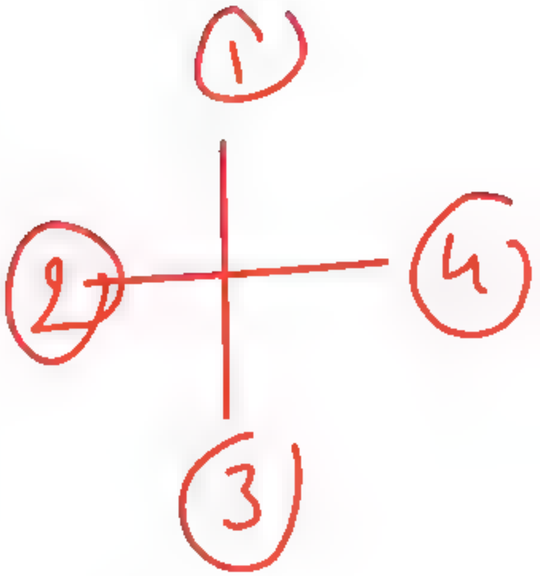

(a)

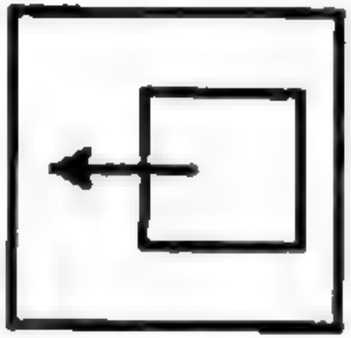

(b)

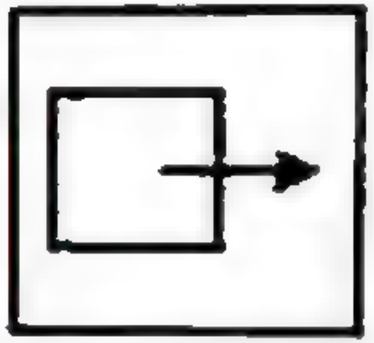

(c)

(d)

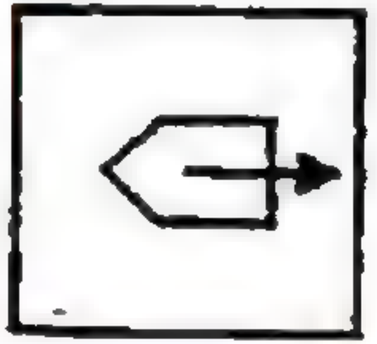

IGacademy Download App in PlayStore | SUBSCRIBE IshwarGiri ಪಾಠಶಾಲೆ | 8660070677

RSI 2023

Q. Complete the sequence.

Q. ಕೆಳಗಿನ ಲೇಖನ ಚಿತ್ರಗಳ ಕ್ರಮವನ್ನು ಪೂರ್ಣಗೊಳಿಸಿ.



(a) (b) (c) (d)



IGacademy Download App in PlayStore | SUBSCRIBE IshwarGiri ಪಾಠಶಾಲೆ | 8660070677

RSI 2023



(a) (b) (c) (d)



IGacademy Download App in PlayStore | SUBSCRIBE IshwarGiri ಪಾಠಶಾಲೆ | 8660070677

Q. Select the figure that will come next in the following figure series.

Q. ಕೆಳಗಿನ ಸರಣಿಯಲ್ಲಿ ಮುಂದೆ ಬರುವ ಚಿತ್ರವನ್ನು ಆಯ್ಕೆಮಾಡಿ.

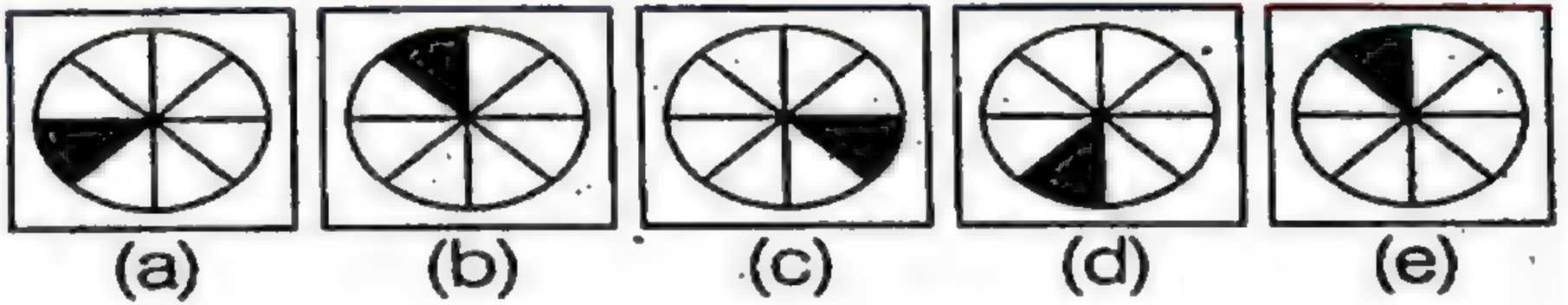

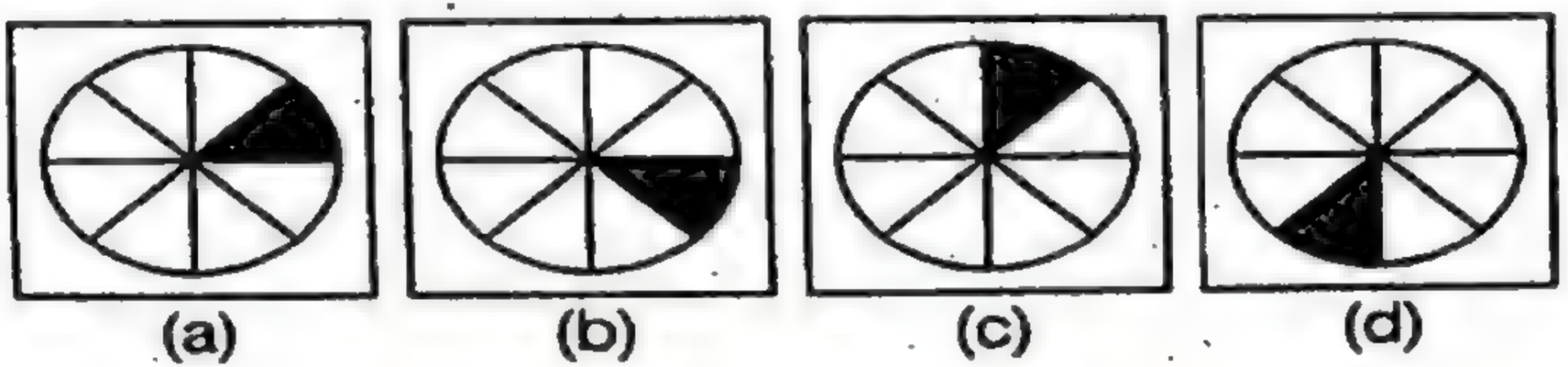

IGacademy Download App in PlayStore | SUBSCRIBE IshwarGiri ಪಾಠಶಾಲೆ | 8660070677

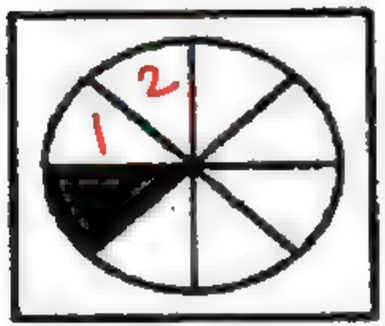

(a)

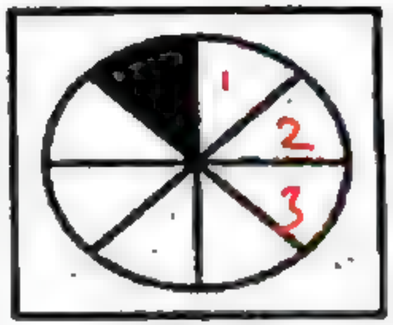

(b)

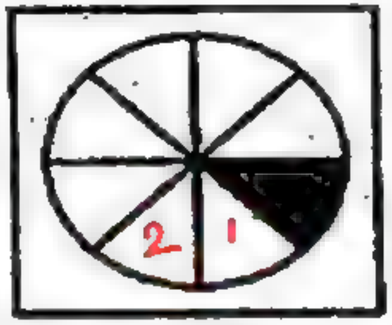

(c)

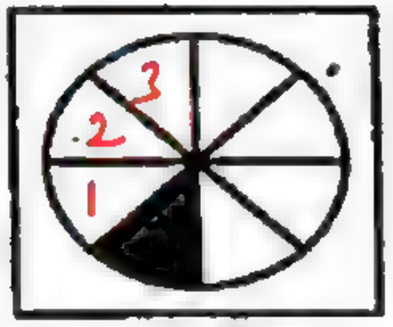

(d)



(e)

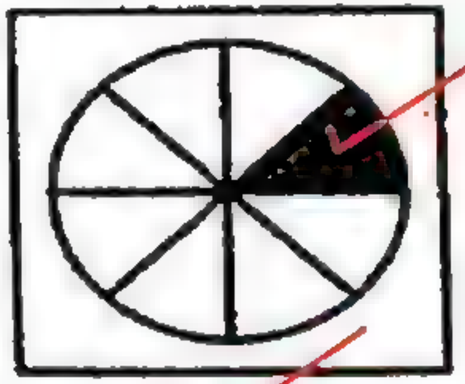

(a)

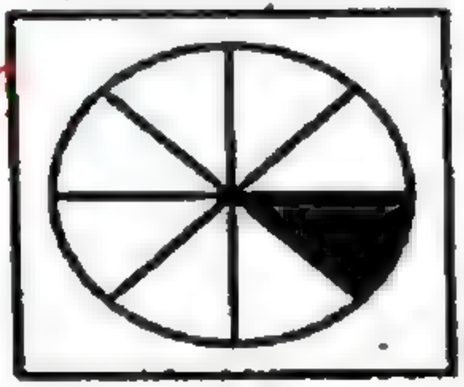

(b)



(c)

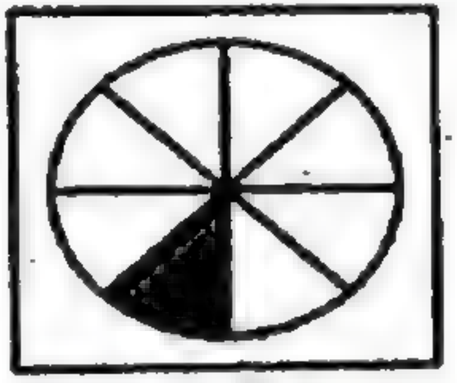

(d)



IGacademy Download App in PlayStore | SUBSCRIBE IshwarGiri ಪಾಠಶಾಲೆ | 8660070677

KSISF - PSI - 2020

Q. Select the figure that will come next in the following figure series.

Q. ಕೆಳಗಿನ ಸರಣಿಯಲ್ಲಿ ಮುಂದೆ ಬರುವ ಚಿತ್ರವನ್ನು ಆಯ್ಕೆಮಾಡಿ.

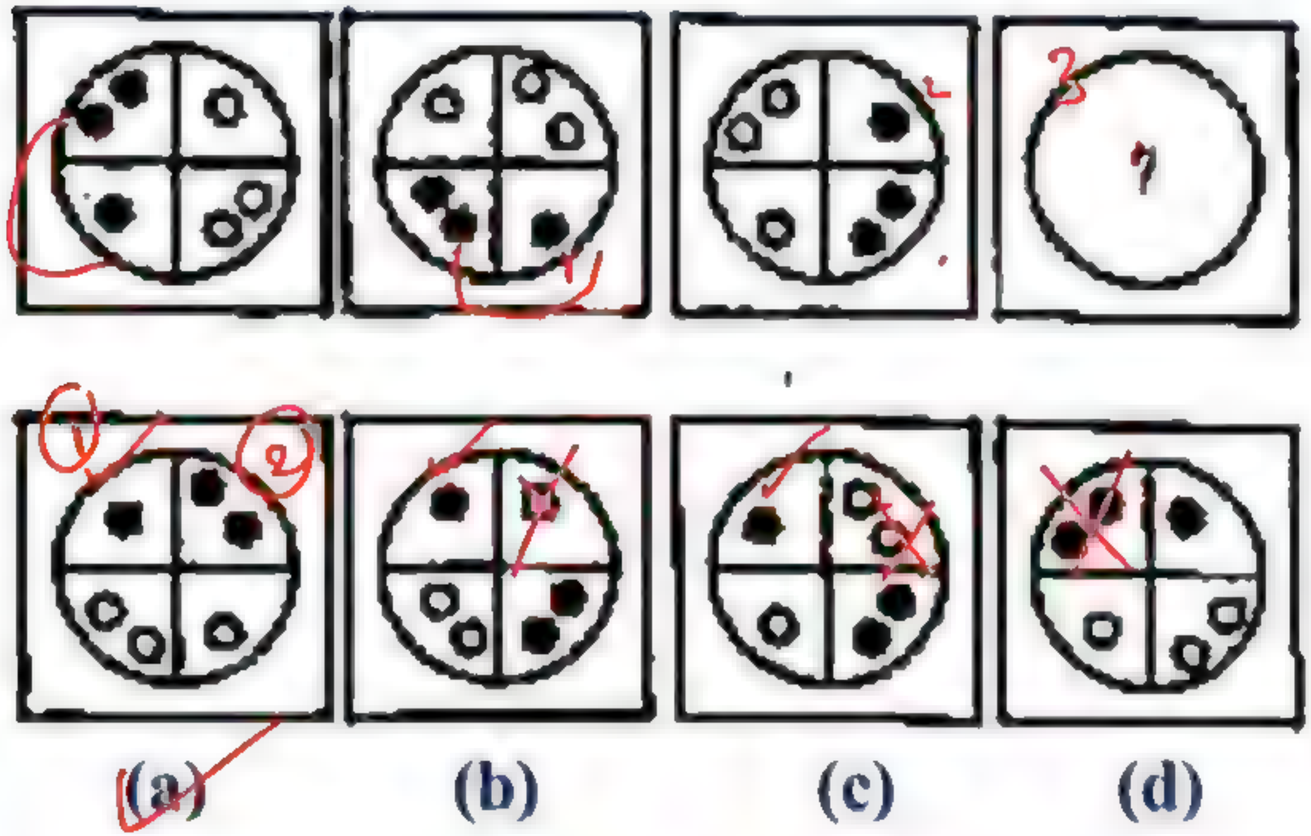

IGacademy Download App in PlayStore | SUBSCRIBE IshwarGiri ಪಾಠಶಾಲೆ | 8660070677

KSISF - PSI - 2020

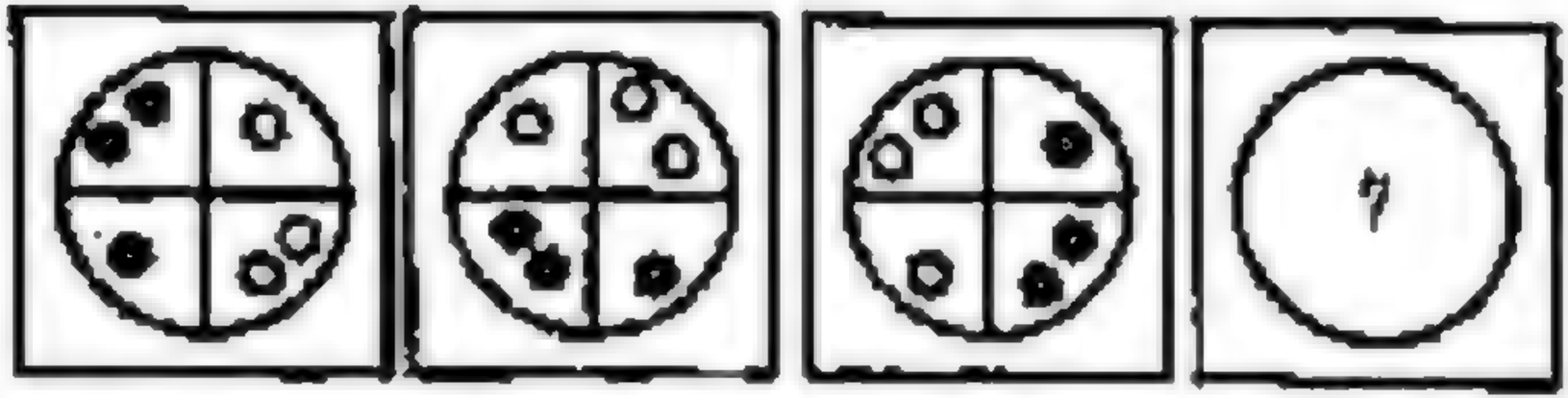

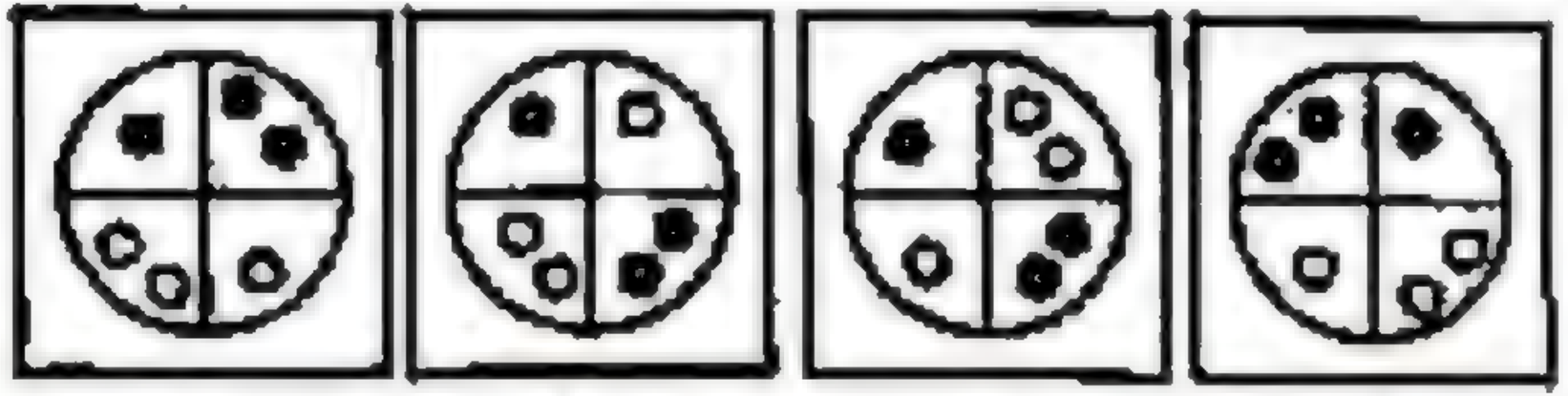

(a) (b) (c) (d)

IGacademy Download App in PlayStore | SUBSCRIBE IshwarGiri ಪಾಠಶಾಲೆ | 8660070677

Q. Select the figure from among the given options that can replace the question mark (?) in the following series.

Q. ಈ ಕೆಳಗಿನ ಸರಣಿಯಲ್ಲಿ ಪ್ರಶ್ನಾರ್ಥಕ ಚಿಹ್ನೆಯನ್ನು (?) ಬದಲಿಸಬಹುದಾದ ಆಯ್ಕೆಗಳ ಪೈಕಿ ಆಕೃತಿಯನ್ನು ಆಯ್ಕೆಮಾಡಿ.

Question Figures

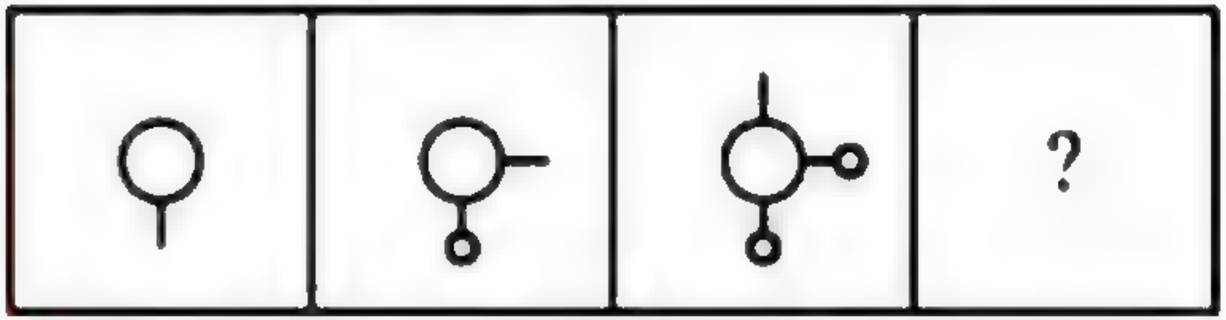

Answer Figures

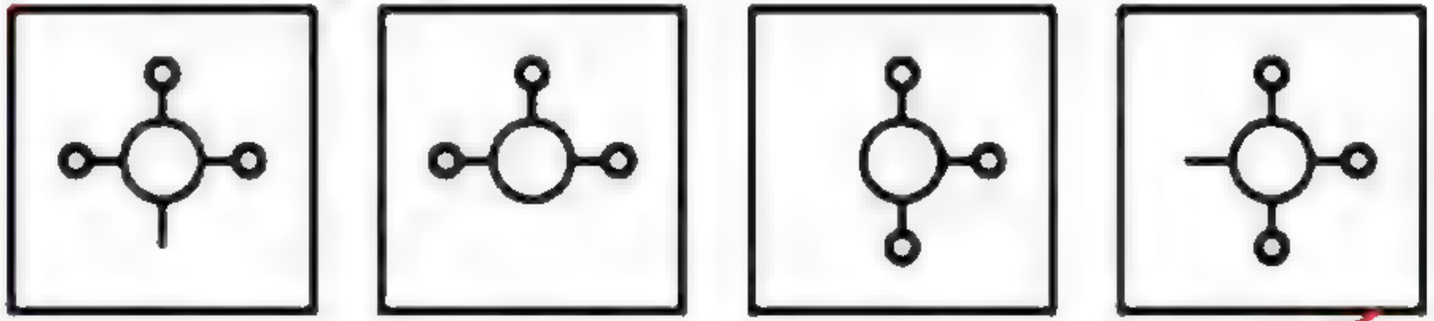

(a) (b) (c) (d)

IGacademy Download App in PlayStore | SUBSCRIBE IshwarGiri ಪಾಠಶಾಲೆ | 8660070677

Question Figures

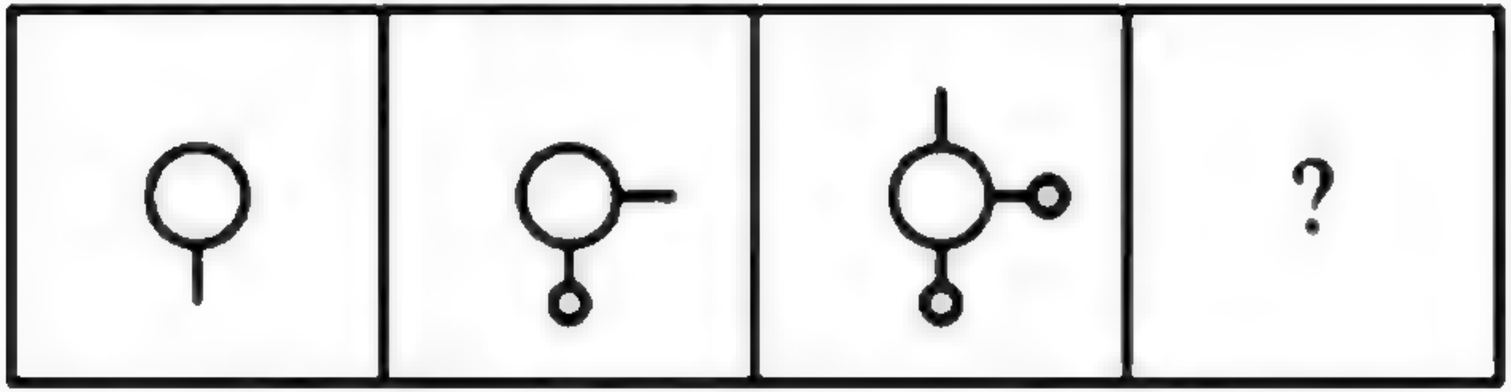

Answer Figures

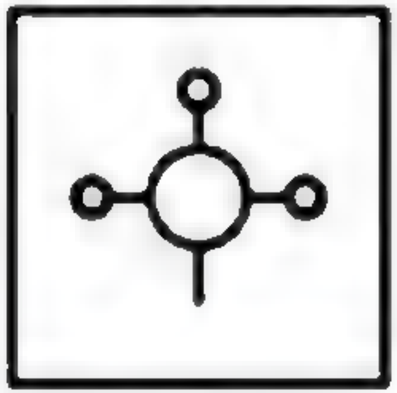

(a)

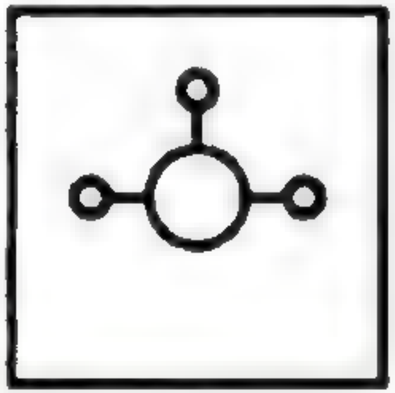

(b)

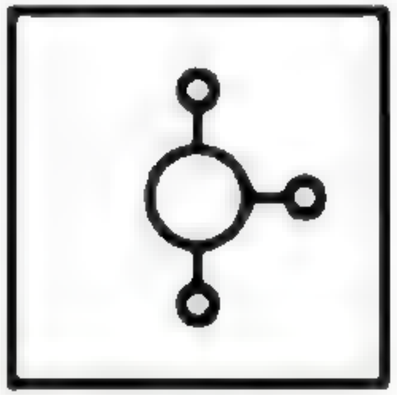

(c)

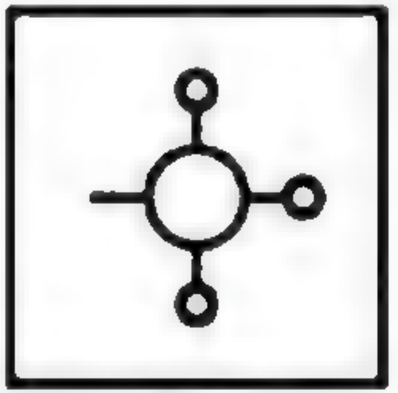

(d)

IGacademy Download App in PlayStore | SUBSCRIBE IshwarGiri ಪಾಠಶಾಲೆ | 8660070677

Q. Select the figure from among the given options that can replace the question mark (?) in the following series.

Q. ಈ ಕೆಳಗಿನ ಸರಣಿಯಲ್ಲಿ ಪ್ರಶ್ನಾರ್ಥಕ ಚಿಹ್ನೆಯನ್ನು (?) ಬದಲಿಸಬಹುದಾದ ಆಯ್ಕೆಗಳ ಪೈಕಿ ಆಕೃತಿಯನ್ನು ಆಯ್ಕೆಮಾಡಿ.

Question Figures

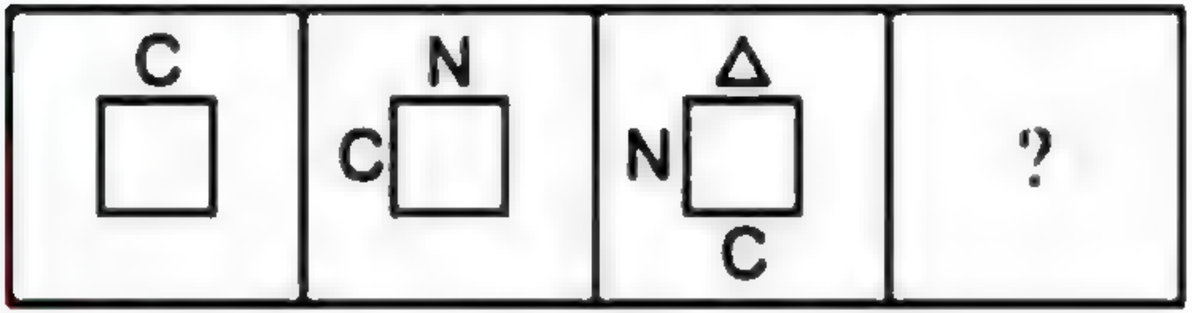

Answer Figures

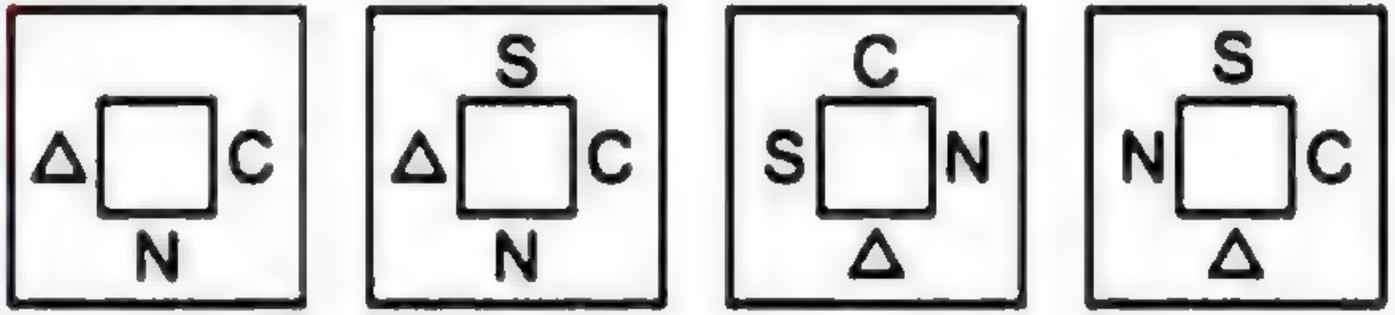

(a) (b) (c) (d)

IGacademy Download App in PlayStore | SUBSCRIBE IshwarGiri ಪಾಠಶಾಲೆ | 8660070677

Question Figures

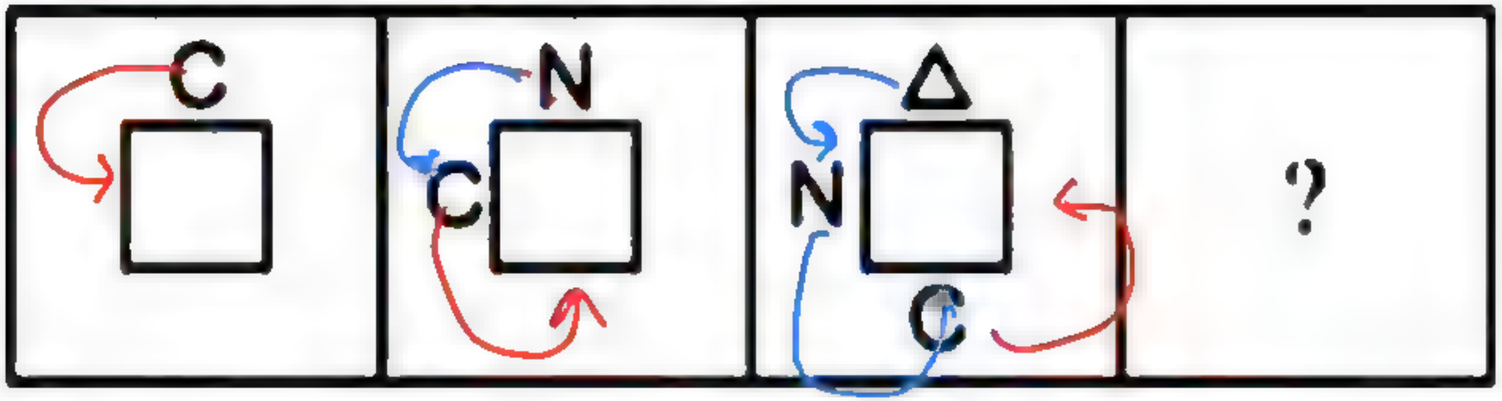

Answer Figures

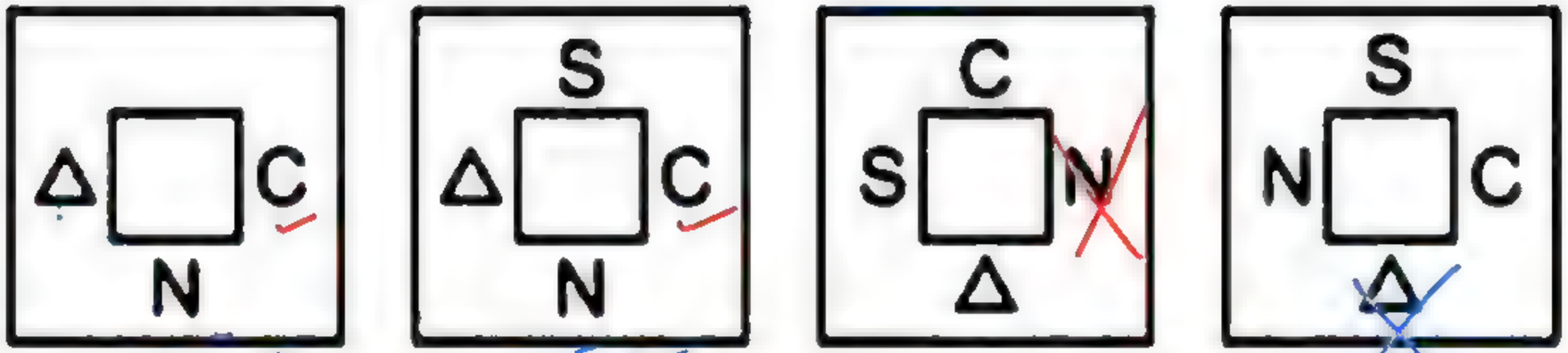

(a) (b) (c) (d)

IGacademy Download App in PlayStore | SUBSCRIBE IshwarGiri ಪಾಠಶಾಲೆ | 8660070677

Q. Select the figure from among the given options that can replace the question mark (?) in the following series.

Q. ಈ ಕೆಳಗಿನ ಸರಣಿಯಲ್ಲಿ ಪ್ರಶ್ನಾರ್ಥಕ ಚಿಹ್ನೆಯನ್ನು (?) ಬದಲಿಸಬಹುದಾದ ಆಯ್ಕೆಗಳ ಪೈಕಿ ಆಕೃತಿಯನ್ನು ಆಯ್ಕೆಮಾಡಿ.

Question Figures

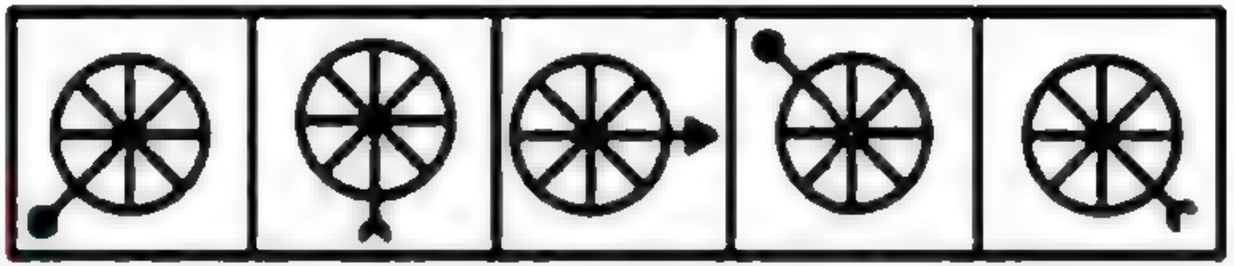

Answer Figures



(a) (b) (c) (d)

IGacademy Download App in PlayStore | SUBSCRIBE IshwarGiri ಪಾಠಶಾಲೆ | 8660070677

Question Figures

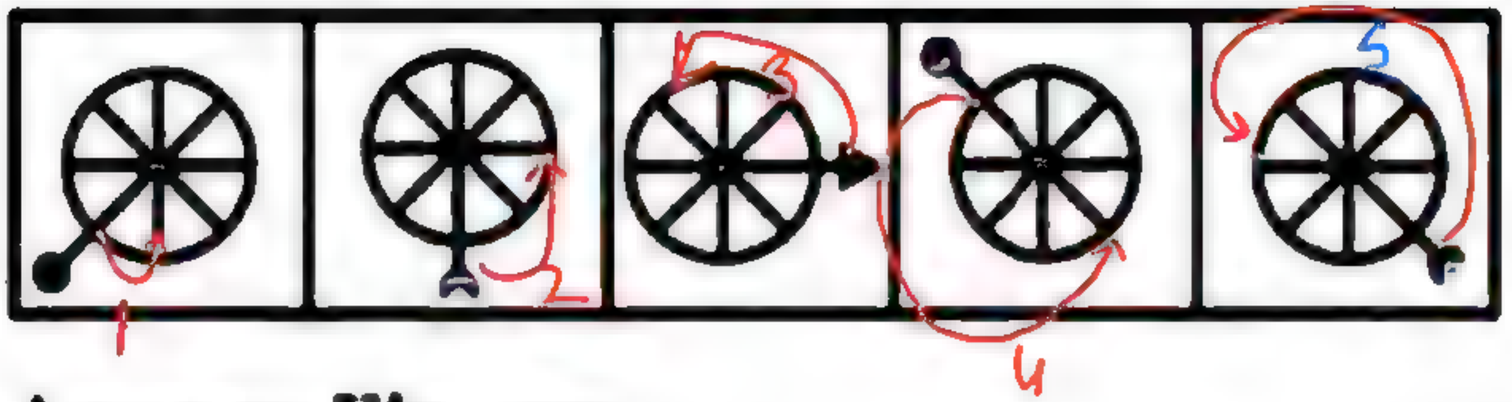

Answer Figures

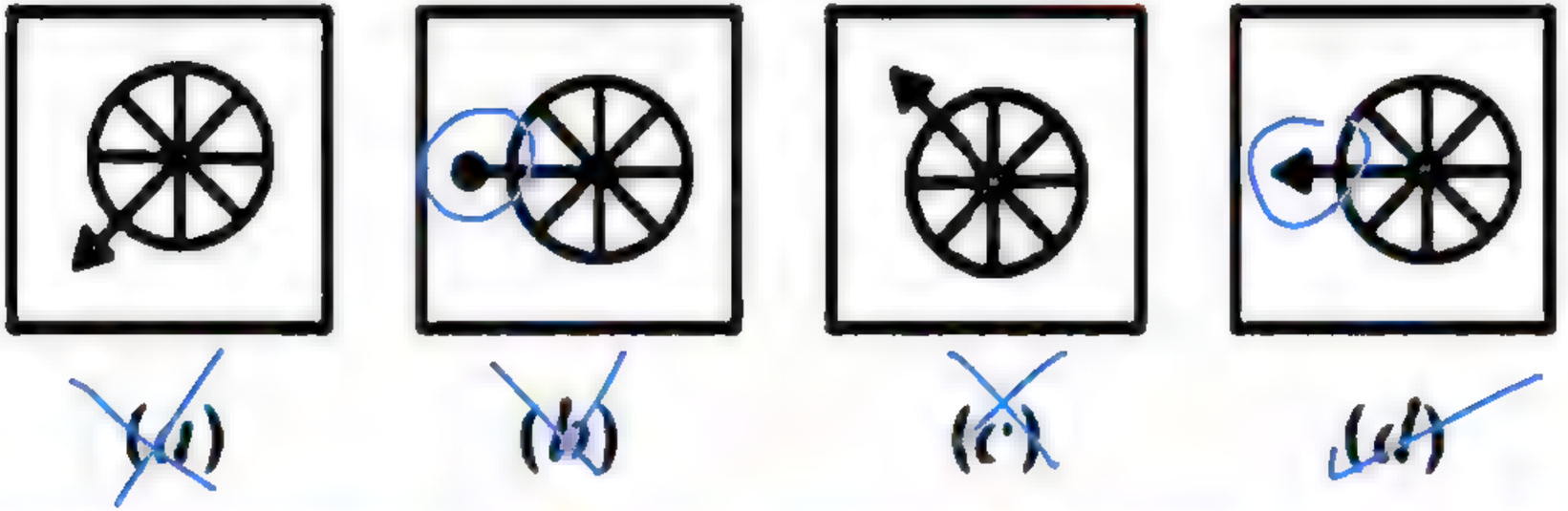

IGacademy Download App in PlayStore | SUBSCRIBE IshwarGiri ಪಾಠಶಾಲೆ | 8660070677

SI (KSISF) & SRSI (KSRP) – 2017

Q. Which of the following answer figure completes the series?

Q. ಕೆಳಗಿನವುಗಳಲ್ಲಿ ಯಾವ ಉತ್ತರ ಚಿತ್ರ ಸರಣಿಯನ್ನು ಪೂರ್ಣಗೊಳಿಸುತ್ತದೆ?

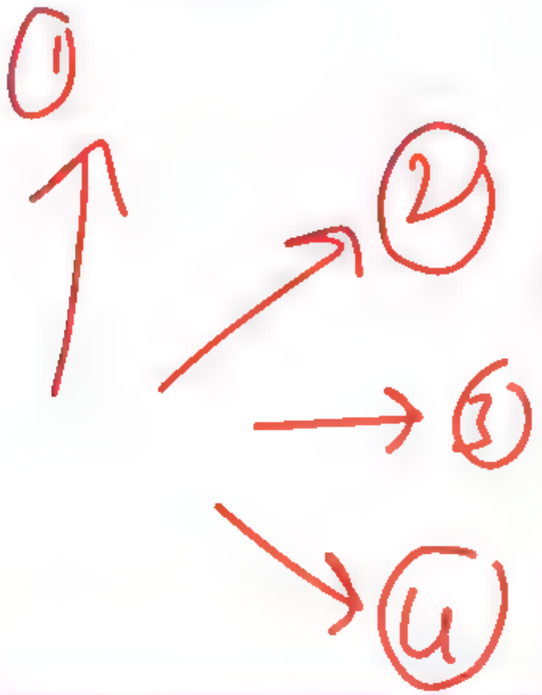

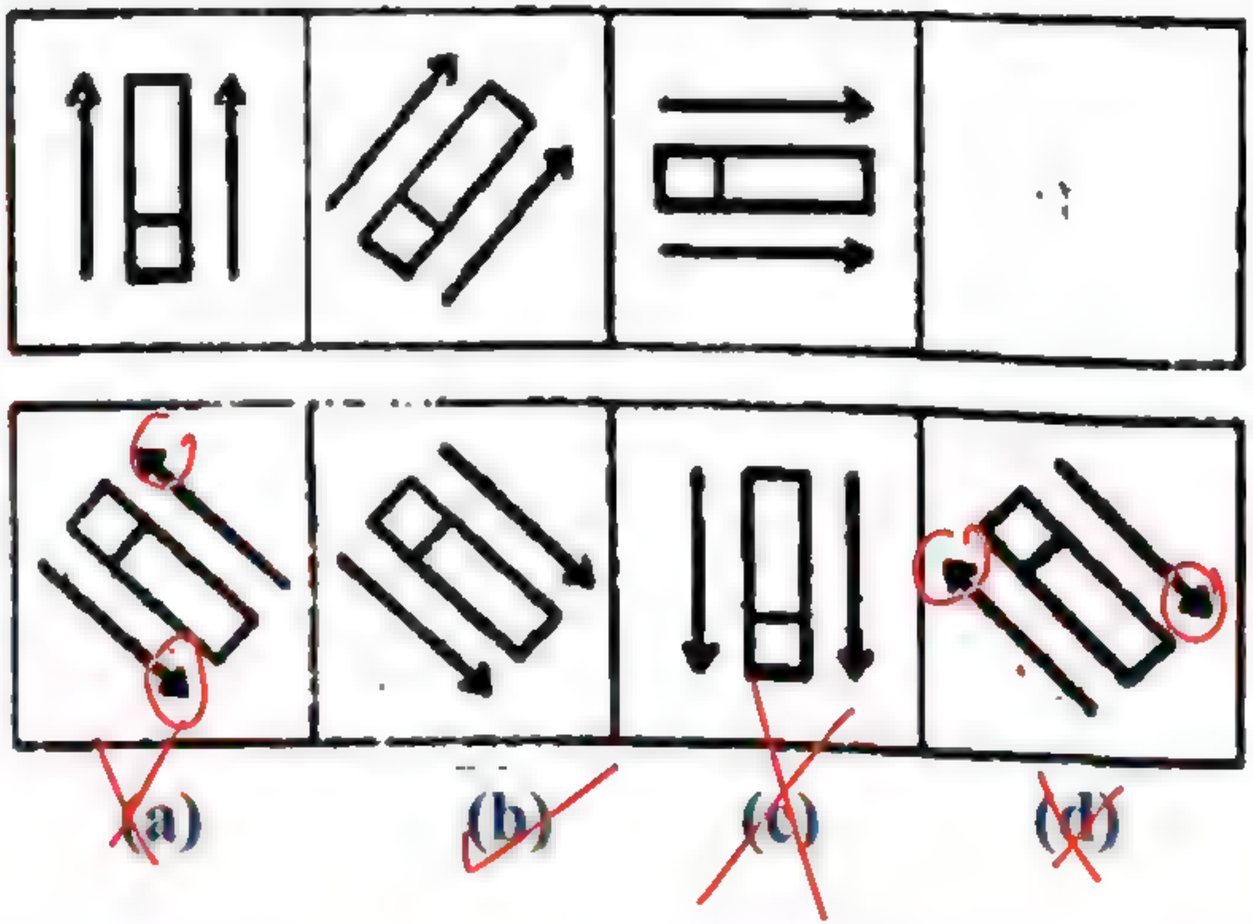

IGacademy Download App in PlayStore | SUBSCRIBE IshwarGiri ಪಾಠಶಾಲೆ | 8660070677

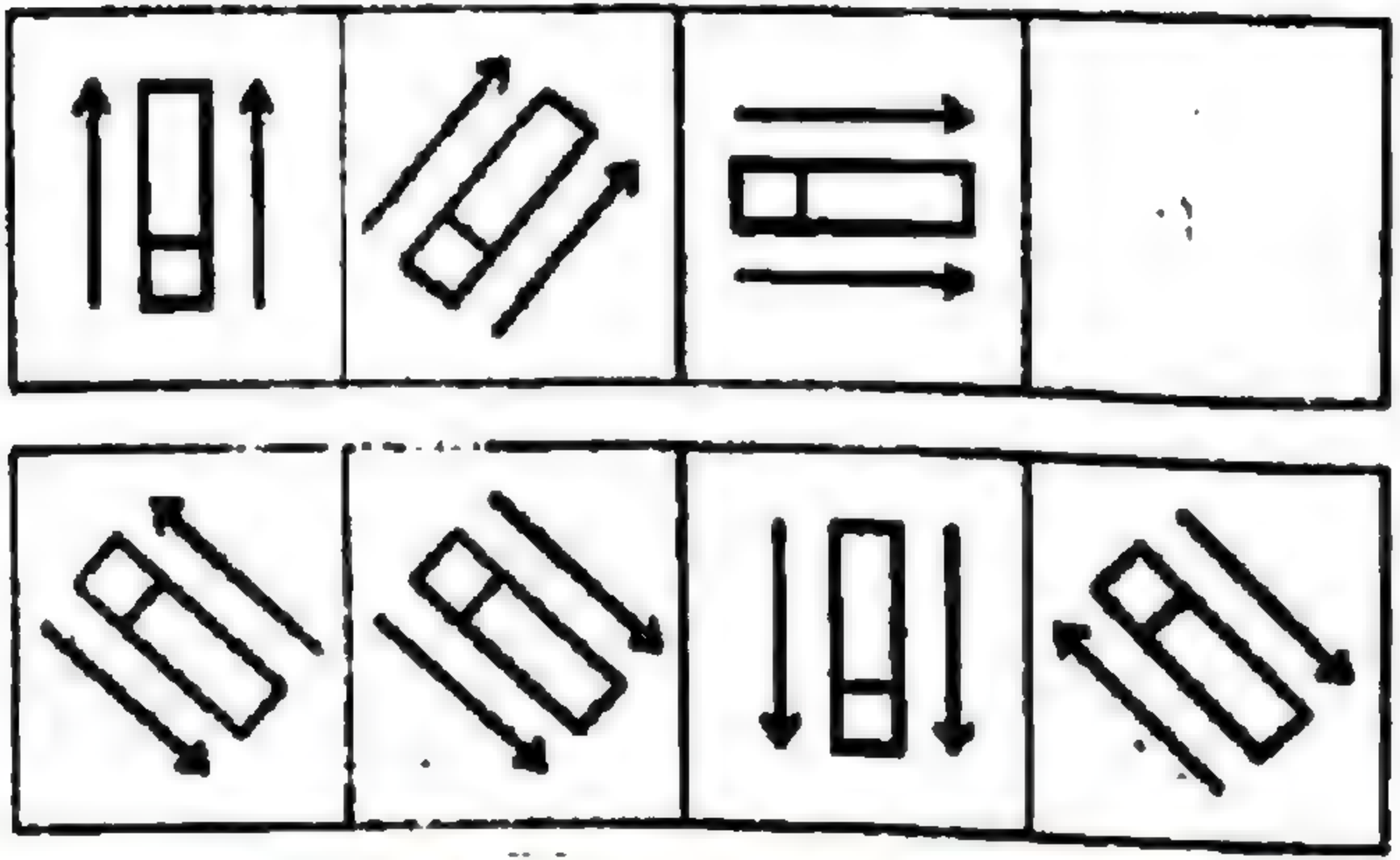

(a) (b) (c) (d)

IGacademy Download App in PlayStore | SUBSCRIBE IshwarGiri ಪಾಠಶಾಲೆ | 8660070677

PSI 2024

Q. In the question given below, which picture should come next to the question mark to logically complete the given series of pictures?

Q. ಈ ಕೆಳಗೆ ನೀಡಲಾದ ಪ್ರಶ್ನೆಯಲ್ಲಿ, ನೀಡಲಾಗಿರುವ ಚಿತ್ರಗಳ ಸರಣಿಯನ್ನು ತಾರ್ಕಿಕವಾಗಿ ಪೂರ್ಣಗೊಳಿಸಲು ಪ್ರಶ್ನಾರ್ಥಕ ಚಿಹ್ನೆಯಿರುವಲ್ಲಿ ಯಾವ ಚಿತ್ರ ಬರಬೇಕು?

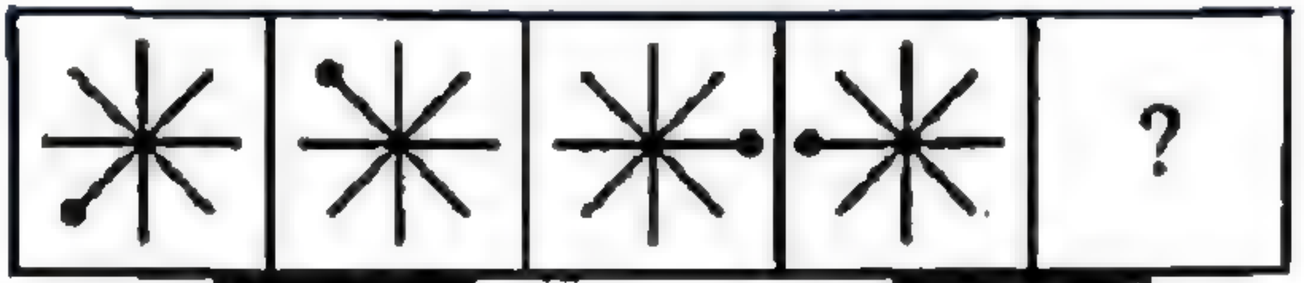

(A)

(B) 

(C) 

(D) 

IGacademy Download App in PlayStore | SUBSCRIBE IshwarGiri ಪಾಠಶಾಲೆ | 8660070677

PSI 2024

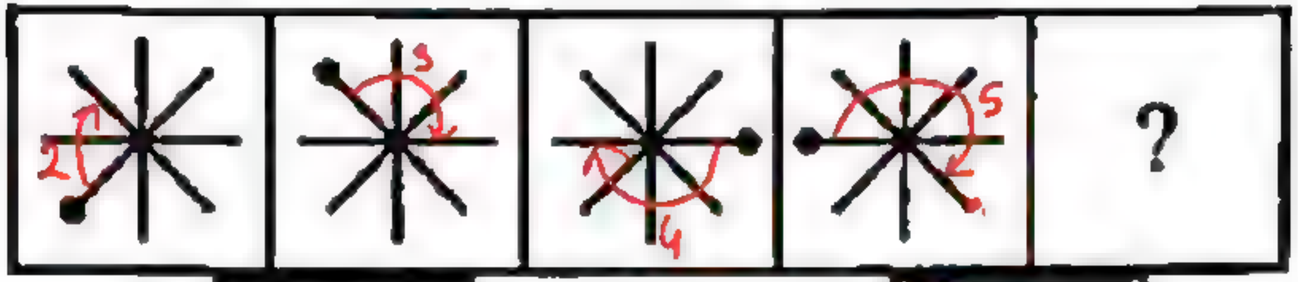

(A) 

(B) 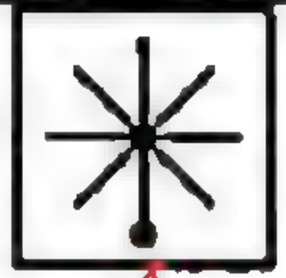

(C)

(D) 

IGacademy Download App in PlayStore | SUBSCRIBE IshwarGiri ಪಾಠಶಾಲೆ | 8660070677

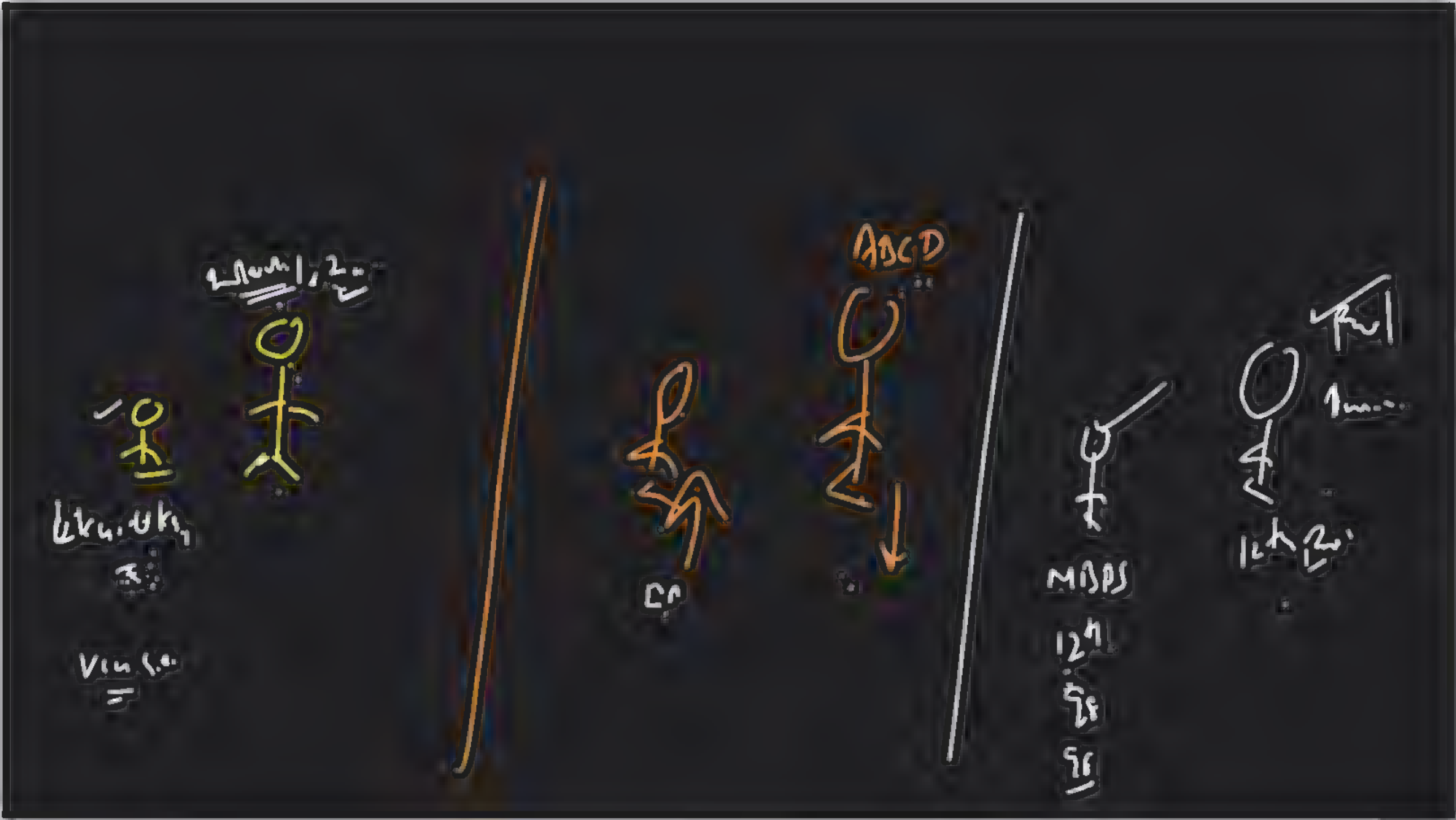
ABCD



ESI – 2019

Q. The following question has 2 types of statistics.

1. PROBLEM FIGURE is marked A, B, C, D.
2. ANSWER FIGURE is marked as (1), (2), (3), (4). You need to select an image from the ANSWER FIGURE that should continue the PROBLEM FIGURE series.

Q. ಈ ಕೆಳಗಿನ ಪ್ರಶ್ನೆಯಲ್ಲಿ 2 ವಿಧದ ಅಂಕಿ ಅಂಶಗಳಿವೆ .

1. PROBLEM FIGURE ಅನ್ನು A , B , C , D ಎಂದು ಗುರುತಿಸಲಾಗಿದೆ .
2. ANSWER FIGURE ನ್ನು (1) , (2) , (3) , (4) ಎಂದು ಗುರುತಿಸಲಾಗಿದೆ .

PROBLEM FIGURE ಸರಣಿಯನ್ನು ಮುಂದುವರಿಸುವ ಚಿತ್ರವನ್ನು ನೀವು ANSWER FIGURE ನಿಂದ ಆರಿಸಬೇಕಾಗುತ್ತದೆ.

PROBLEM FIGURE.

A B C D

ANSWER FIGURE



(1) (2) (3) (4)

IGacademy Download App in PlayStore | SUBSCRIBE IshwarGiri ಪಾಠಶಾಲೆ | 8660070677

ESI – 2019

PROBLEM FIGURE.



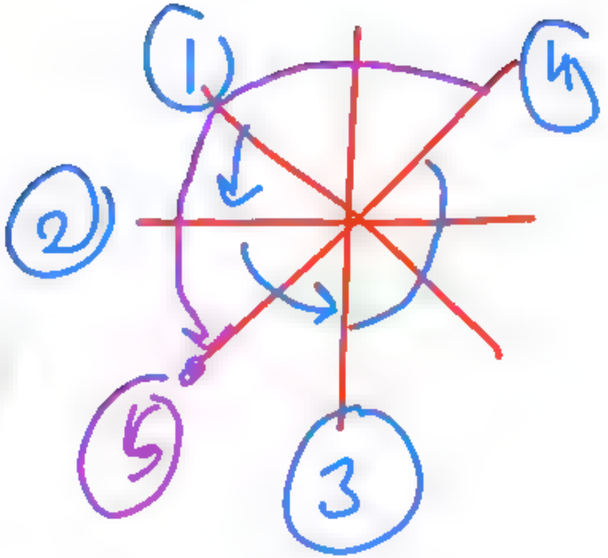

ANSWER FIGURE



IGacademy Download App in PlayStore | SUBSCRIBE IshwarGiri ಪಾಠಶಾಲೆ | 8660070677

Q. Which of the following answer figure completes the series?

Q. ಕೆಳಗಿನವುಗಳಲ್ಲಿ ಯಾವ ಉತ್ತರ ಚಿತ್ರ ಸರಣಿಯನ್ನು ಪೂರ್ಣಗೊಳಿಸುತ್ತದೆ?

(a) 1 (b) 2
(c) 3 (d) 4

Question Figures :



Answer Figures :

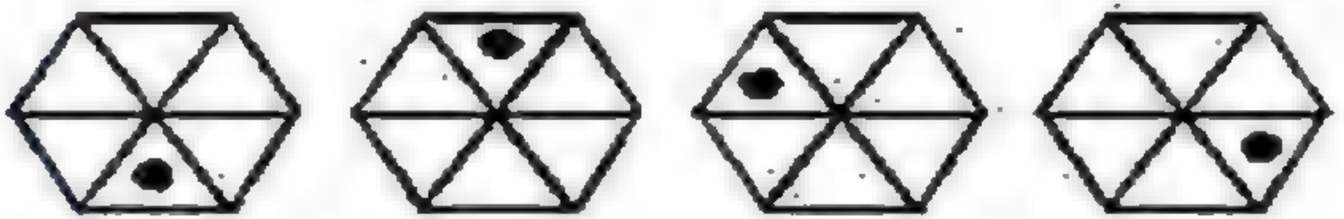

(1) (2) (3) (4)

IGacademy Download App in PlayStore | SUBSCRIBE IshwarGiri ಪಾಠಶಾಲೆ | 8660070677

Question Figures :

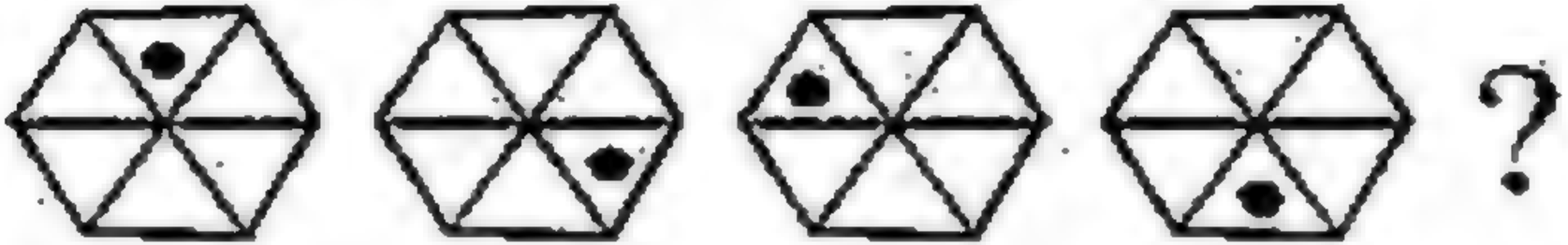

Answer Figures :

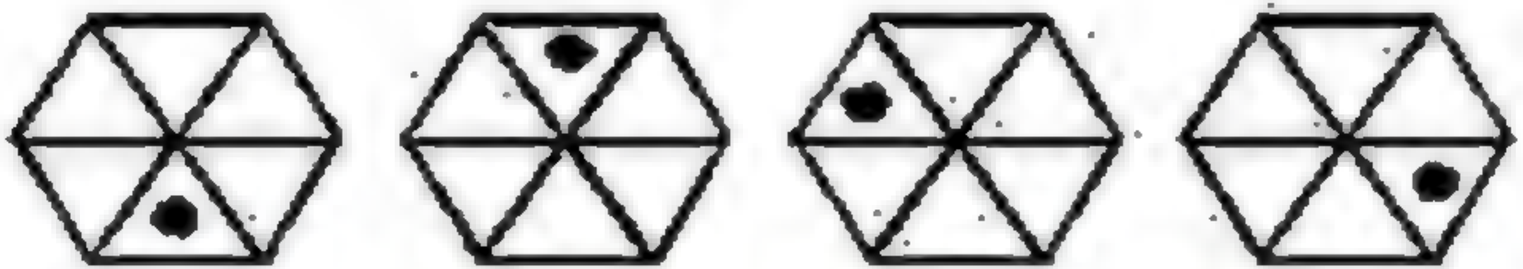

(1) (2) (3) (4)

IGacademy Download App in PlayStore | SUBSCRIBE IshwarGiri ಪಾಠಶಾಲೆ | 8660070677

Q. Select the missing figure from the given responses.

Q. ನೀಡಿರುವ ಆಯ್ಕೆಗಳಿಂದ ಕಾಣೆಯಾದ ಚಿತ್ರವನ್ನು ಆಯ್ಕೆಮಾಡಿ

(a) 1 **(b) 2**

(c) 3 **(d) 4**



Answers Figures :



(1) (2) (3) (4)

IGacademy Download App in PlayStore | SUBSCRIBE IshwarGiri ಪಾಠಶಾಲೆ | 8660070677



Answers Figures :

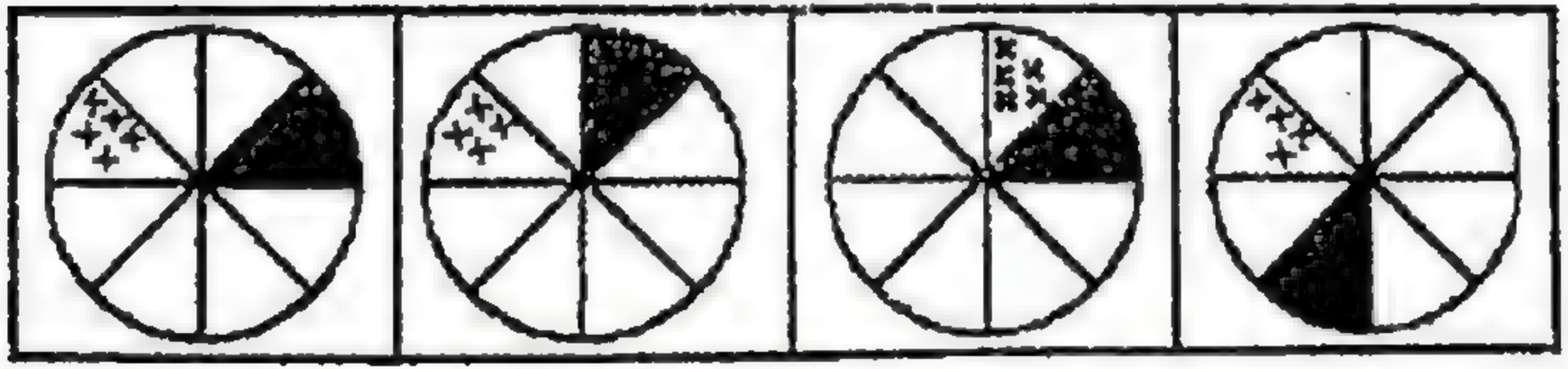

(1) (2) (3) (4)

IGacademy Download App in PlayStore | SUBSCRIBE IshwarGiri ಪಾಠಶಾಲೆ | 8660070677

KAS - 2015

Q. Select the figure that will come next in the following figure series.

Q. ಕೆಳಗಿನ ಸರಣಿಯಲ್ಲಿ ಮುಂದೆ ಬರುವ ಚಿತ್ರವನ್ನು ಆಯ್ಕೆಮಾಡಿ.

a.

b. 

c. 

d.

IGacademy Download App in PlayStore | SUBSCRIBE IshwarGiri ಪಾಠಶಾಲೆ | 8660070677

KAS - 2015



a. 

b.

c.

d. 

IGacademy Download App in PlayStore | SUBSCRIBE IshwarGiri ಪಾಠಶಾಲೆ | 8660070677

FDA - 2017

Q. Observe the following figures and which figure will fit in next box

Q. ಈ ಚಿತ್ರಗಳನ್ನು ಗಮನಿಸಿ ಚೌಕದಲ್ಲಿ ಮುಂದೆ ಬರುವ ಆಕೃತಿಯನ್ನು ಗುರುತಿಸಿ.

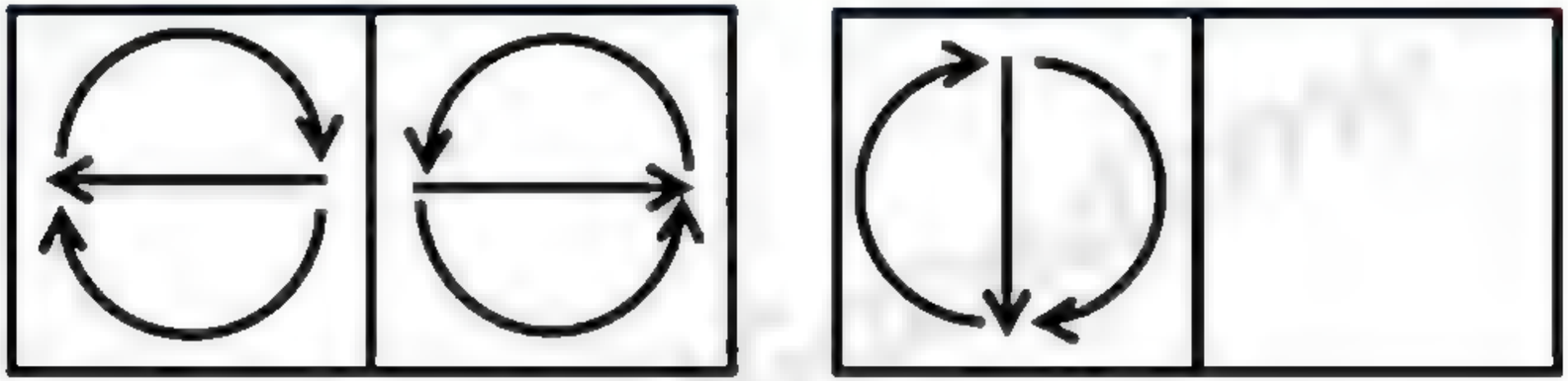

(a)

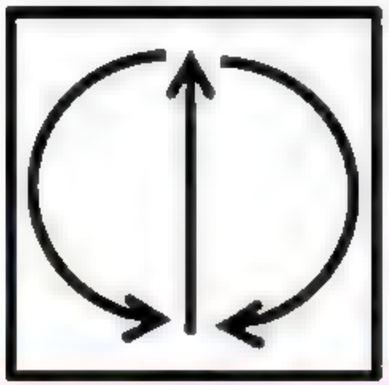

(b)

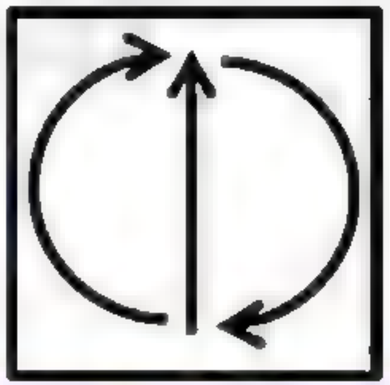

(c)

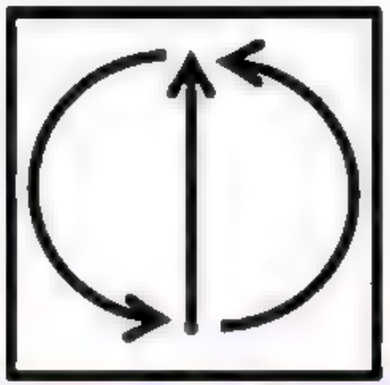

(d)



IGacademy Download App in PlayStore | SUBSCRIBE IshwarGiri ಪಾಠಶಾಲೆ | 8660070677

FDA - 2017

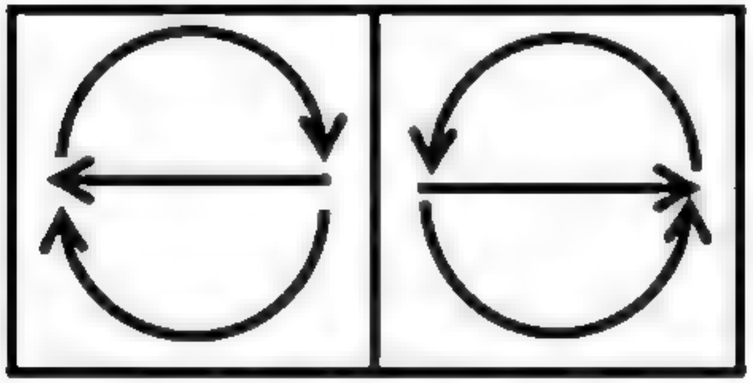

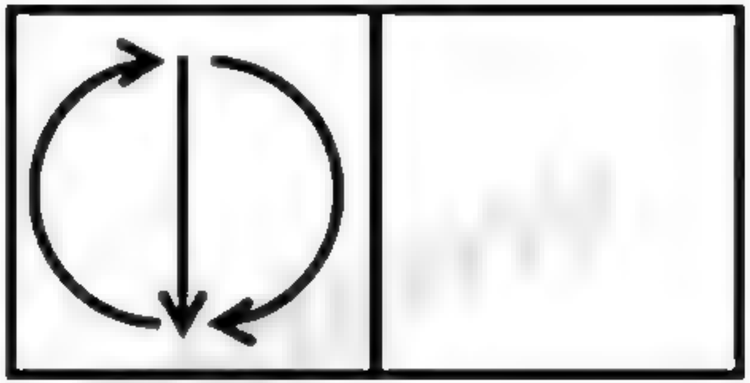

(a)

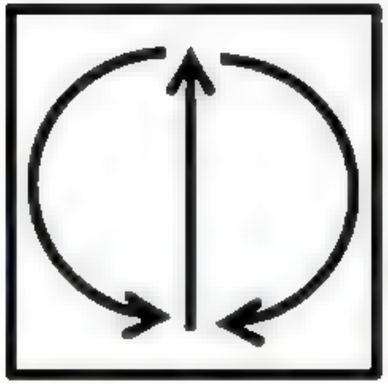

(b)



(c)

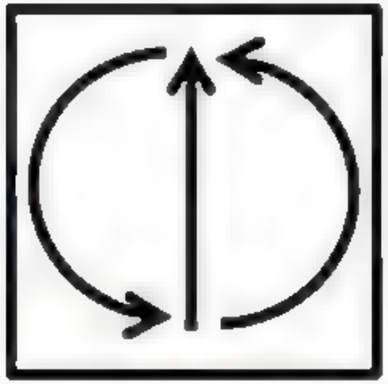

(d)



IGacademy Download App in PlayStore | SUBSCRIBE IshwarGiri ಪಾಠಶಾಲೆ | 8660070677

Q. What is next figure in given series?

Q. ನೀಡಿರುವ ಸರಣಿಯಲ್ಲಿ ಮುಂದಿನ ಆಕೃತಿ ಯಾವುದು?

(a) D (b) B

(c) C (d) A

Question Figure:

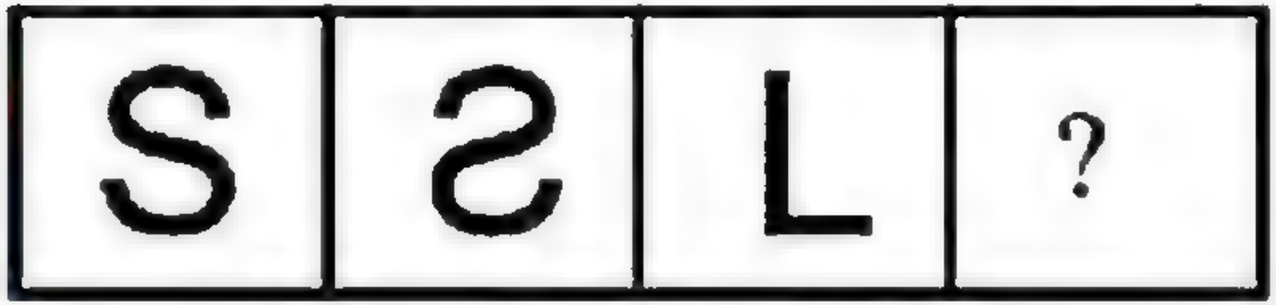

Answer Figure:



A B C D

IGacademy Download App in PlayStore | SUBSCRIBE IshwarGiri ಪಾಠಶಾಲೆ | 8660070677

Question Figure:

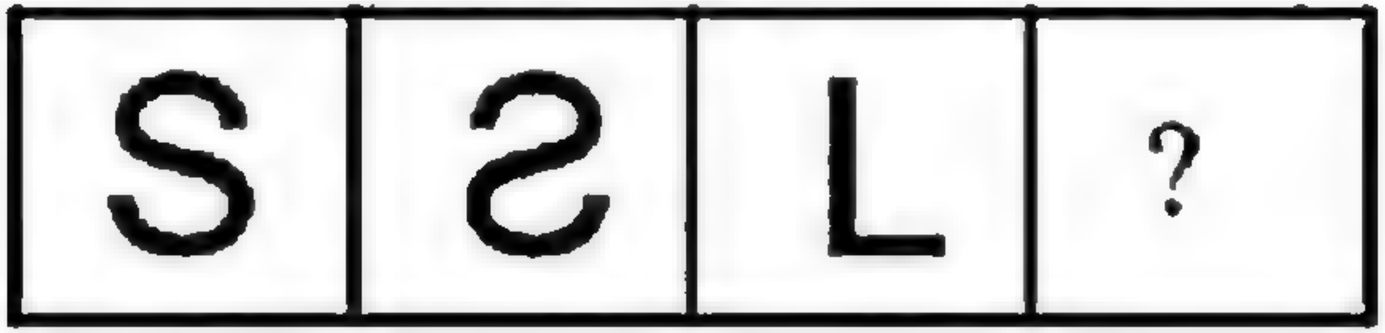

Answer Figure:



A B C D

IGacademy Download App in PlayStore | SUBSCRIBE IshwarGiri ಪಾಠಶಾಲೆ | 8660070677

PSI – 2002

Q. Select the figure that will come next in the following figure series.

Q. ಕೆಳಗಿನ ಸರಣಿಯಲ್ಲಿ ಮುಂದೆ ಬರುವ ಚಿತ್ರವನ್ನು ಆಯ್ಕೆಮಾಡಿ.

ಎ



ಬಿ

ಸಿ

ಡಿ



ಎ

ಬಿ

ಸಿ

ಡಿ

IGacademy Download App in PlayStore | SUBSCRIBE IshwarGiri ಪಾಠಶಾಲೆ | 8660070677

PSI – 2002

ಎ



ಬಿ

ಸಿ

ಡಿ



ಎ

ಬಿ

ಸಿ

ಡಿ

IGacademy Download App in PlayStore | SUBSCRIBE IshwarGiri ಪಾಠಶಾಲೆ | 8660070677

CPC - 2008

Q. Select the figure that will come next in the following figure series.

Q. ಕೆಳಗಿನ ಸರಣಿಯಲ್ಲಿ ಮುಂದೆ ಬರುವ ಚಿತ್ರವನ್ನು ಆಯ್ಕೆಮಾಡಿ.



ಎ)
ಬಿ)
ಸಿ) 
ಡಿ)

IGacademy Download App in PlayStore | SUBSCRIBE IshwarGiri ಪಾಠಶಾಲೆ | 8660070677

CPC - 2008

ಎ)

ಬಿ) 

ಸಿ) 

ಡಿ)

IGacademy Download App in PlayStore | SUBSCRIBE IshwarGiri ಪಾಠಶಾಲೆ | 8660070677

FDA - 2018

Q. Choose the correct figure from the answer figures that comes in the place of question mark (?) in the following question figure.

Q. ಈ ಕೆಳಗಿನ ಸಮಸ್ಯೆಯ ಚಿತ್ರದಲ್ಲಿ ಪ್ರಶ್ನಾರ್ಥಕ ಚಿಹ್ನೆಯುಳ್ಳ (?) ಸ್ಥಳಕ್ಕೆ ಹೊಂದಿಕೆಯಾಗಬಲ್ಲ ಸರಿ ಚಿತ್ರವನ್ನು ಉತ್ತರದ ಚಿತ್ರಗಳಿಂದ ಆರಿಸಿ.

ಪ್ರಶ್ನೆ ಚಿತ್ರ:



ಸರಿಯಾದ ಆಯ್ಕೆಯನ್ನು ಆರಿಸಿ:

(1)

(2) 

(3)

(4) 

IGacademy Download App in PlayStore | SUBSCRIBE IshwarGiri ಪಾಠಶಾಲೆ | 8660070677

ಪ್ರಶ್ನೆ ಚಿತ್ರ:



ಸರಿಯಾದ ಆಯ್ಕೆಯನ್ನು ಆರಿಸಿ:

(1)

(2) 

(3)

(4) 

IGacademy Download App in PlayStore | SUBSCRIBE IshwarGiri ಪಾಠಶಾಲೆ | 8660070677

thank
you

PSI

6 Am ⇒ 1) Gratitude [illegible] (5 Mins)

2) Affirmation (5 min) . 15 min

3) Visualization (picture) (5 min)

4) [illegible] (Action) 20 [illegible]

Yoga nidra

[illegible] [illegible] [illegible] ↑

21 [illegible]

10 pm Maths . .